NAME : TOTAL MARKS : / 100

Section A

Circle the correct answers. 40%

Bulatkan jawapan yang betul.

1. _____ is a non-living thing.
   _____ ialah bukan hidupan.
   - **A** Rose
     Ros
   - **B** Horse
     Kuda
   - **C** Bread
     Roti

2. Which are the characteristics of living things?
   Yang manakah ialah ciri-ciri bagi hidupan?
   - I Need shelters
     Memerlukan tempat perlindungan
   - II Can breathe
     Boleh bernafas
   - III Can move
     Boleh bergerak
   - **A** I and II
     I dan II
   - **B** I and III
     I dan III
   - **C** II and III
     II dan III

3. Which of the following food can give us energy?
   Antara makanan berikut, yang manakah boleh memberikan kita tenaga?
   - **A**
     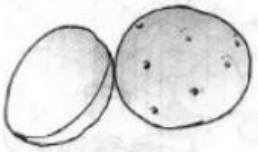
   - **B**

   - **C**
     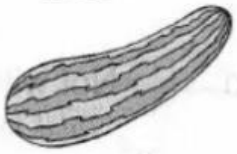

4. This is a description of a person.
   Ini ialah satu penerangan tentang seseorang.

   - She has no teeth.
     Dia tidak mempunyai gigi.
   - She cannot talk.
     Dia tidak boleh bercakap.
   - She can cry and smile.
     Dia boleh nangis dan senyum.

LIVEWORKSHEETS

She is
Dia ialah

A a girl
seorang budak perempuan

B a baby
seorang bayi

C a woman
seorang wanita

5. The picture shows the foods of an animal.
Gambar ini menunjukkan makanan bagi suatu haiwan.

Which animal eats the above foods?
Haiwan yang manakah makan makanan di atas?

A Goat
Kambing

B Giraffe
Zirafah

C Chicken
Ayam

6.

eggs *telur*	→ Z →	butterfly *rama-rama*

Z is a
Z ialah

A caterpillar
beluncas

B tadpole
berudu

C larva
larva

7.

What will happen to the plant after a week?
Apakah yang akan berlaku terhadap tumbuhan selepas seminggu?

A Wilted
Layu

B Grow well
Tumbuh dengan sihat

C Not Wilted
Tidak layu

LIVEWORKSHEETS

8. Which is the seed of a durian?
Yang manakah ialah biji benih durian?

A 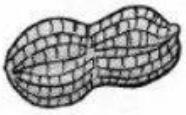

B

C 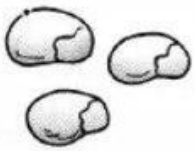

9. Which is taller than humans?
Yang manakah lebih tinggi daripada manusia?

A House
Rumah

B Chair
Kerusi

C Cat
Kucing

10.

Object *Objek*	Length *Panjang*
X	3 paper clips *3 klip kertas*
Y	2 paper clips *2 klip kertas*
X	5 paper clips *5 klip kertas*

Which object is the shortest?
Objek yang manakah paling pendek?

A Object X
Objek X

B Object Y
Objek Y

C Object Z
Objek Z

11. A _____ supplies electricity.
_____ *membekalkan elektrik.*

A battery
Bateri

B bulb
Mentol

C wire
Wayar

12. Which of the following objects can be used as non-standard measuring tool?
Antara objek berikut, yang manakah boleh digunakan sebagai alat pengukur bukan piawai?

A

B 

C

LIVEWORKSHEETS

13. Which objects use batteries to function?
Objek yang manakah menggunakan bateri untuk berfungsi?

I Clock
Jam

II Radio
Radio

III Pencil box
Kotak pensel

A I and II
I dan II

B I and III
I dan III

C II and III
II dan III

14. All the following bulbs will light on **except**
Mentol berikut akan menyala, ***kecuali***

A



B



C

15. _____ can dissolve in water.
_____ boleh larut dalam air.

A Sugar
Gula

B Sponge
Span

C Tissue paper
Kertas tisu

16. Which is matched correctly?
Antara berikut, yang manakah dipadankan dengan betul?

K Baking powder – can dissolve
Serbuk penaik – boleh larut

L Tea – cannot dissolve
Teh – tidak larut

M Salt – can dissolve
Garam – boleh larut

A K and L
K dan L

B K and M
K dan M

C L and M
L dan M

LIVEWORKSHEETS

17. The picture below shows an experiment.
Gambar berikut menunjukkan suatu eksperimen.

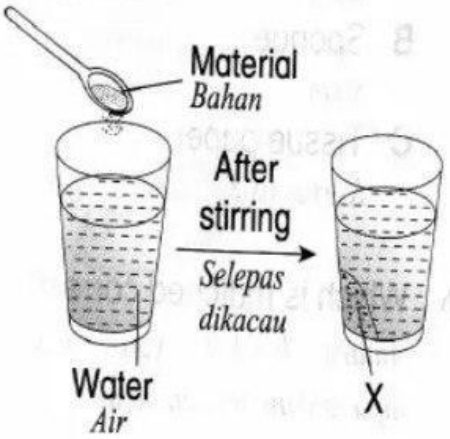

X is
X ialah

A filter
turas

B water
air

C residue
baki

18. Which is a pulling action?
Yang manakah ialah aksi menarik?

A Bend
Membengkok

B Stretch
Meregang

C Squeeze
Memicit

19.



This is a _____ action.
Ini ialah suatu aksi _____.

A pull
menarik

B push
menolak

C pushing and pulling
menolak dan menarik

20. If we push the ball harder, it will
Jika kita menolak bola dengan lebih kuat, ia akan

A move faster
bergerak lebih cepat

B stop moving
henti bergerak

C move slower
bergerak lebih perlahan

LIVEWORKSHEETS

Section B

Answer all questions. **60%**

Jawab semua soalan.

1. **Put 'L' for the living things and put 'N' for the non-living things.** (16%)

   Letakkan ' L ' bagi hidupan dan letakkan ' N ' bagi bukan hidup.



LIVEWORKSHEETS

2. **Complete the table below with the correct answers.** (24%)
Lengkapkan jadual berikut dengan jawapan yang betul.

Meat
Daging

Vegetable
Sayur

Bread
Roti

Soya beans
Kacang soya

Noodles
Mi

Apple
Epal

Food that gives us energy ***Makanan yang memberikan kita tenaga***

Food that helps us to stay healthy ***Makanan yang membantu kita mengekalkan kesihatan***

Food that helps us to grow ***Makanan yang membantu kita membesar***

LIVEWORKSHEETS

3. **Put a tick (✓) for the correct answers.** (4%)
Tandakan (✓) bagi jawapan yang betul.

Animal *Haiwan*	**Eats plants** *Makan tumbuhan*	**Eats animals** *Makan haiwan*	**Eats plants and other animals** *Makan tumbuh-tumbuhan dan haiwan lain*
Duck *Itik*			
Zebra *Zebra*			
Crocodile *Buaya*			
Butterfly *Rama-rama*			

LIVEWORKSHEETS

4. Circle the correct answers. (16%)

Bulatkan jawapan yang betul.

a		e	
can dissolve *boleh larut*	cannot dissolve *tidak boleh larut*	push *tolak*	pull *tarik*
b 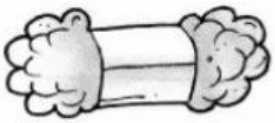		f	
can dissolve *boleh larut*	cannot dissolve *tidak boleh larut*	push *tolak*	pull *tarik*
c		g	
can dissolve *boleh larut*	cannot dissolve *tidak boleh larut*	squeeze *memicit*	press *menekan*
d		h 	
bend *membengkok*	stretch *meregang*	twist *memulas*	knock *mengetuk*

LIVEWORKSHEETS