Nama Siswa: _____

No Absen: _____

Kelas: _____

Penilaian:

BILANGAN CACAH 1-20

Lengkapilah bilangan cacah di bawah ini dengan benar.

1		3		

Masukan guru _____

Paraf guru _____

Paraf ortu _____

LIVEWORKSHEETS

Nama : Kelas :

PENJUMLAHAN SAMPAI 20

Kerjakanlah operasi hitung penjumlahan matematika di bawah ini dengan tepat!

9 6 + ☐☐	8 5 + ☐☐	9 7 + ☐☐
10 4 + ☐☐	11 7 + ☐☐	12 5 + ☐☐
13 6 + ☐☐	14 3 + ☐☐	15 4 + ☐☐
16 4 + ☐☐	17 2 + ☐☐	18 1 + ☐☐

LIVEWORKSHEETS

MUDAHNYA BELAJAR PENGURANGAN

Hitunglah pengurangan angka di bawah ini dengan benar.



2 - 1 =



4 - 3 =



5 - 3 =



7 - 4 =

9 - 5 =



8 - 2 =



7 - 1 =



10 - 2 =



15 - 5 =

Nama: _____ Nilai: _____ Paraf: _____

Kelas: _____ Absen No: _____ Penilaian: ☆☆☆☆☆

LIVEWORKSHEETS

Nama:

Absen:

Membandingkan bilangan

Bandingkan angka di bawah ini menggunakan tanda (>) lebih dari, (<) kurang dari dengan tepat!

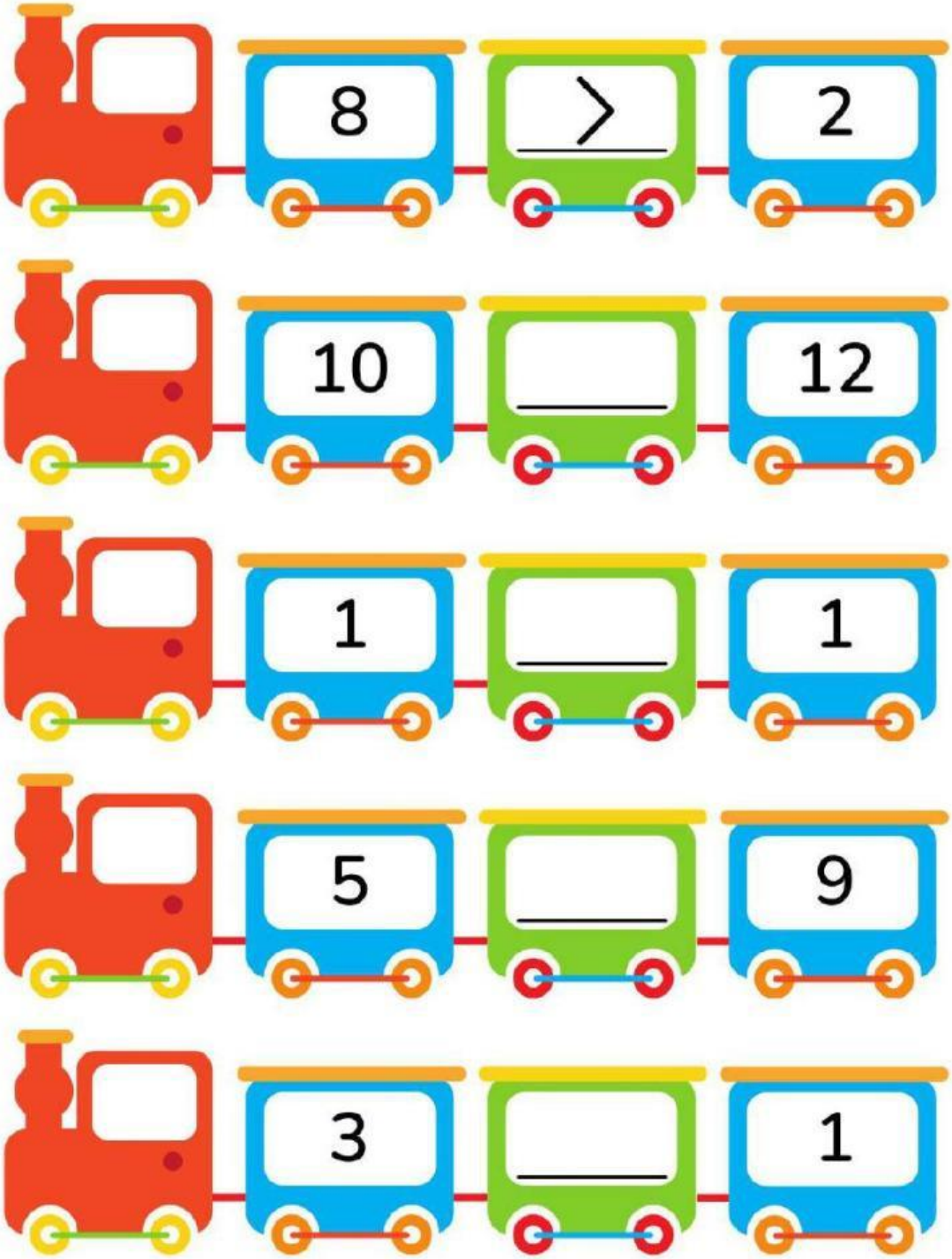

LIVEWORKSHEETS