Nama : _____ Kelas : _____

MENENTUKAN PECAHAN SENILAI

Amati setiap gambar pecahan. Tentukan pecahan yang senilai dengan gambar di sebelah kiri, lalu isilah kotak kosong dengan benar.

1. 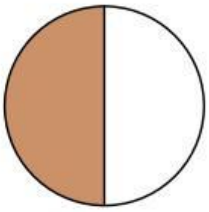 $\frac{1}{2} = \frac{\square}{4}$ 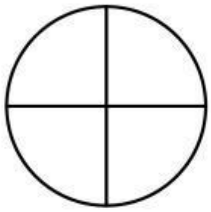

2. 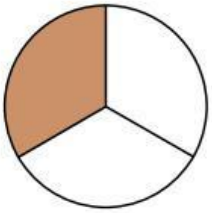 $\frac{1}{3} = \frac{\square}{6}$ 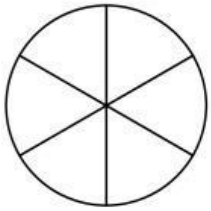

3. 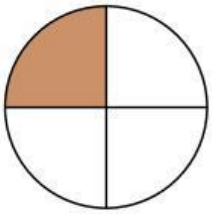 $\frac{1}{4} = \frac{\square}{8}$

4. 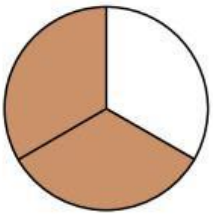 $\frac{2}{3} = \frac{\square}{9}$ 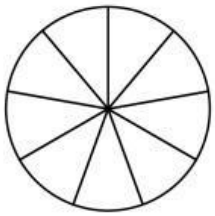

5. 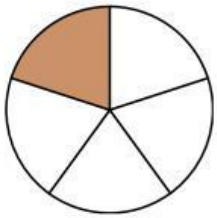 $\frac{1}{5} = \frac{\square}{10}$ 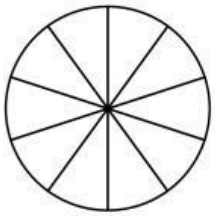

LIVEWORKSHEETS