P3 Term 3 Reviewer

MATHS

A. List the next 5 equivalent fractions of the given fraction.

$$\frac{4}{7} = \frac{\square}{\square} = \frac{\square}{\square} = \frac{\square}{\square} = \frac{\square}{\square} = \frac{\square}{\square}$$

B. Fill in the blanks with the appropriate unit of measurement for each object. Write m, cm, or km.

	The length of a blackboard is about 2 _____.
	The distance from Cavite City to SM MOA is about 28 _____.
	The width of an eraser is about 2 _____.

C. Fill in the missing numbers to complete the indicated measurement.

1 L

410 ml _____ ml

1 kg

150 g _____ g

1 m

35 cm _____ cm

1 km

600 m _____ m

LIVEWORKSHEETS

D. Write the following in kilograms and grams.

1. 6240 g = _____ kg + _____ g
2. 3005 g = _____ kg + _____ g

E. Write the following in meters and centimeters.

1. 718 cm = _____ m + _____ cm
2. 1037 cm = _____ m + _____ cm

F. Find the total volume of water in each set of measuring cups.

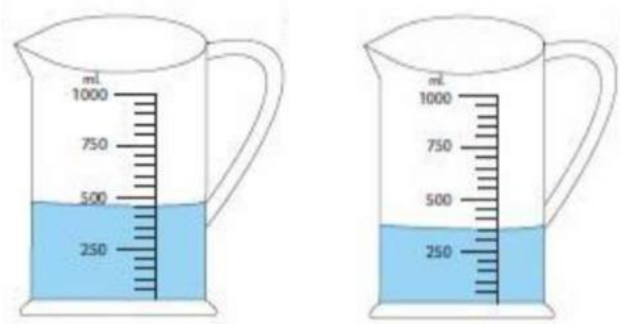

1. _____ ml

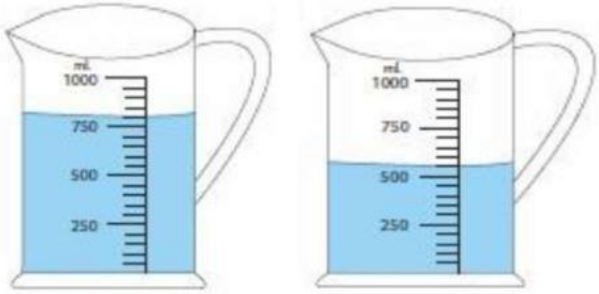

2. _____ ℓ _____ ml

G. Look at the 4 items inside the box.

Golf club	Figure skates	Skateboard	Surfboard
425 g	2 kg 325 g	2 kg 532 g	4005 g

1. The lightest item is the _____.
2. The heaviest item is the _____.
3. The total weight of the figure skates and the golf club is

_____ kg _____ g.

LIVEWORKSHEETS

H. Find the area of each figure in square units.

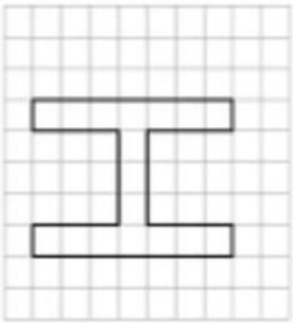

_____ square units

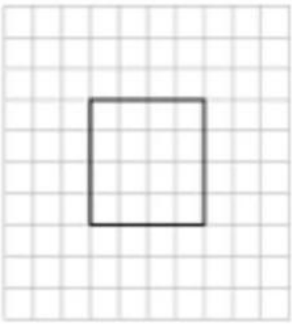

_____ square units



_____ square units

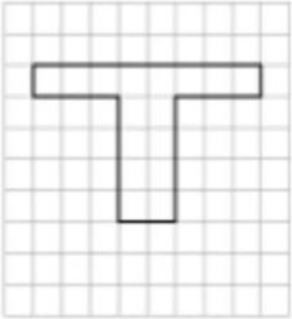

_____ square units

I. Find the area and perimeter of each shape below.

8 cm 3 cm	Area: Perimeter:
20 m	Area: Perimeter:
3 cm 14 cm	Area: Perimeter:

LIVEWORKSHEETS

J. Write the time shown and missing hands on the clock.

1.

_____

2.

_____

3.

9:15

4.

4:51

K. Express the following into minutes.

3 hours	=	_____ minutes
2 hours 15 minutes	=	_____ minutes
1 hour 30 minutes	=	_____ minutes

LIVEWORKSHEETS

L. Express the following into hours.

80 minutes	=	_____ h _____ min
210 minutes	=	_____ h _____ min
500 minutes	=	_____ h _____ min

M. Write the time in a 24-hour clock.

12-hour clock	24-hour clock
5:35 am	
3:30 pm	
9:45 pm	

N. Write the time in the 12-hour clock.

12-hour clock	24-hour clock
	17 00
	00 00
	21 25

O. Solve the problems below. Show your workings and write your final answer in a complete sentence.

1. My father is building a fence around our cats' designated place in our home. The place is rectangular and has a length of 12 m and a breadth of 5 m.
   a. What is the length of the fence needed to go all around the cats' place?
   b. What is the area of the cats' place?

Workings:

Final sentence:

LIVEWORKSHEETS

2. Andy went to play basketball with his friends. Their basketball game lasted 2 h 15 min and ended at 4:00 pm. What time did they start playing basketball?
Workings: Final sentence:
3. Levi drove 800 m going to the park. Barry drove four times as far as Levi. How far did Barry drive? Give your answer in kilometers and meters.
Workings: Final sentence:
4. Mrs. Sy had 5300 g of avocados. She used 2 kg of avocados to make ice cream. How much avocados did she have left? Give your answer in kilograms and grams.
Workings: Final sentence:
5. The drum contained 9 ℓ of water at the start of the day. The construction workers used 5 ℓ 400 ml for mixing cement and used 900 ml to wash their hands after work. How much water is left? Give your answer in litres and millilitres.
Workings: Final sentence:

LIVEWORKSHEETS