16. Calculate the size of the angles marked by letters

(a)

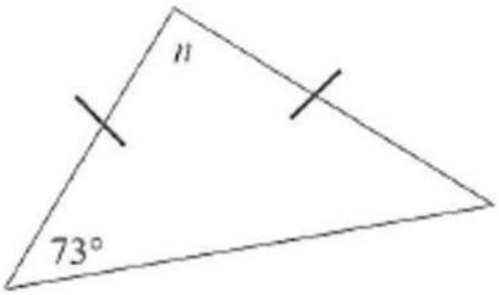

NOT DRAWN TO SCALE

Answer: _____ [3]

(b)



NOT DRAWN TO SCALE

Answer: _____ [3]

16.

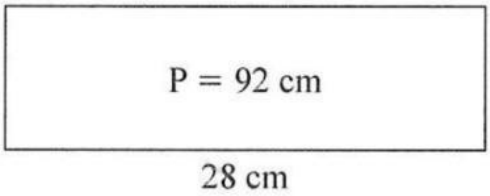

NOT DRAWN TO SCALE

The perimeter of the rectangle above is 92 cm. The length is 28 cm.
Calculate the width of the rectangle.

Answer: _____ cm [3]

LIVEWORKSHEETS

16. Use the words in the box below to label the circle.

"*O*" is the centre of the circle.

diameter	radius	chord	segment

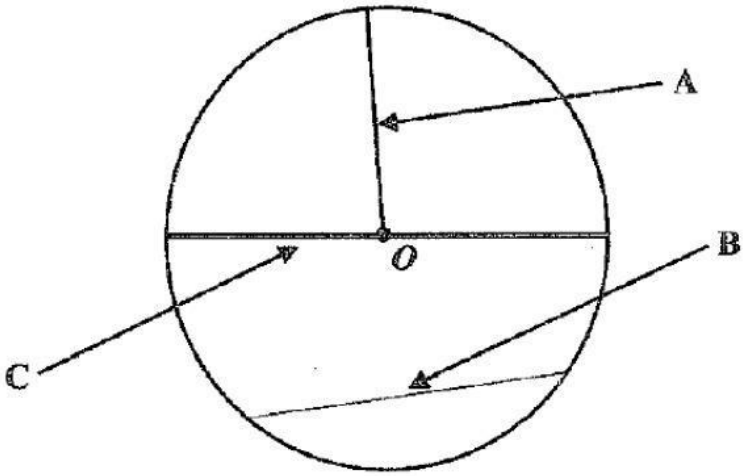

Answer: A _____ [1]

Answer: B _____ [1]

Answer: C _____ [1]

17. Mark left home at 7:24 am and arrived at school at 8:50 am.

(a) How long did Mark take to arrive at school?

Answer: _____ [2]

(b) Express your answer from part (a) in minutes.

Answer: _____ [2]

LIVEWORKSHEETS

16. Farmer Brown has 100 acres of land.

The bar graph below shows the number of acres used for some crop.

Crops Planted by Farmer Brown

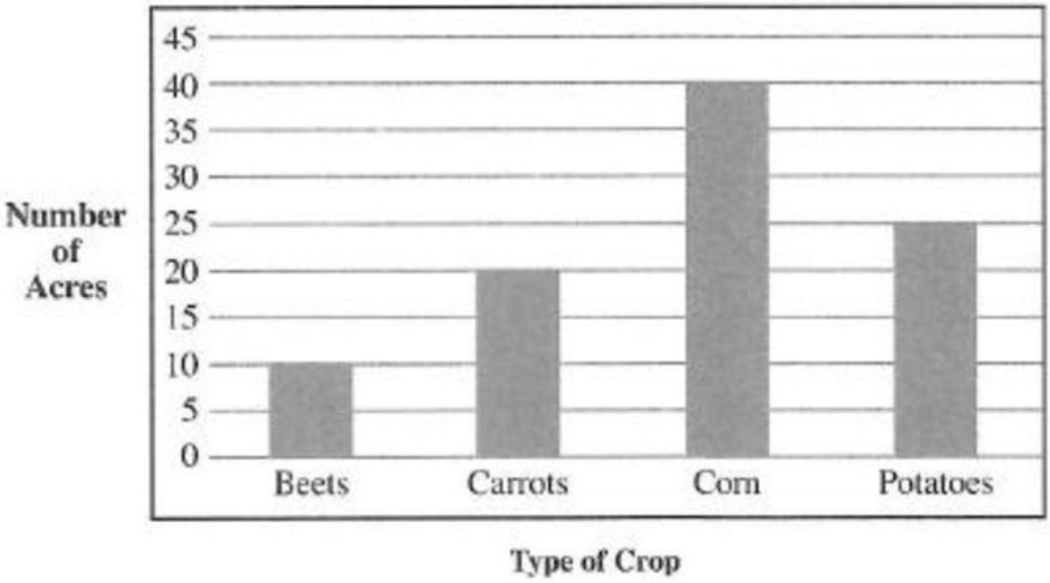

(a) State the number of acres used for corn.

Answer: _____ [1]

(b) State the crop which used the least number of acres.

Answer: _____ [1]

(c) Calculate how many more acres of potatoes were planted than beets.

Answer: _____ [2]

Farmer Brown wants to plant some cabbage.

(d) Find how many acres are available for him to plant the cabbage.

Answer: _____ [2]

LIVEWORKSHEETS