LKPD MATEMATIKA

Kelas 1 SD

PENJUMLAHAN DAN PENGURANGAN



Nama: _____

Kelas: _____

LIVEWORKSHEETS

PENJUMLAHAN

Kelas 1 SD

Nama: _____

Kelas: _____

Hitunglah jumlah gambar berikut ini:

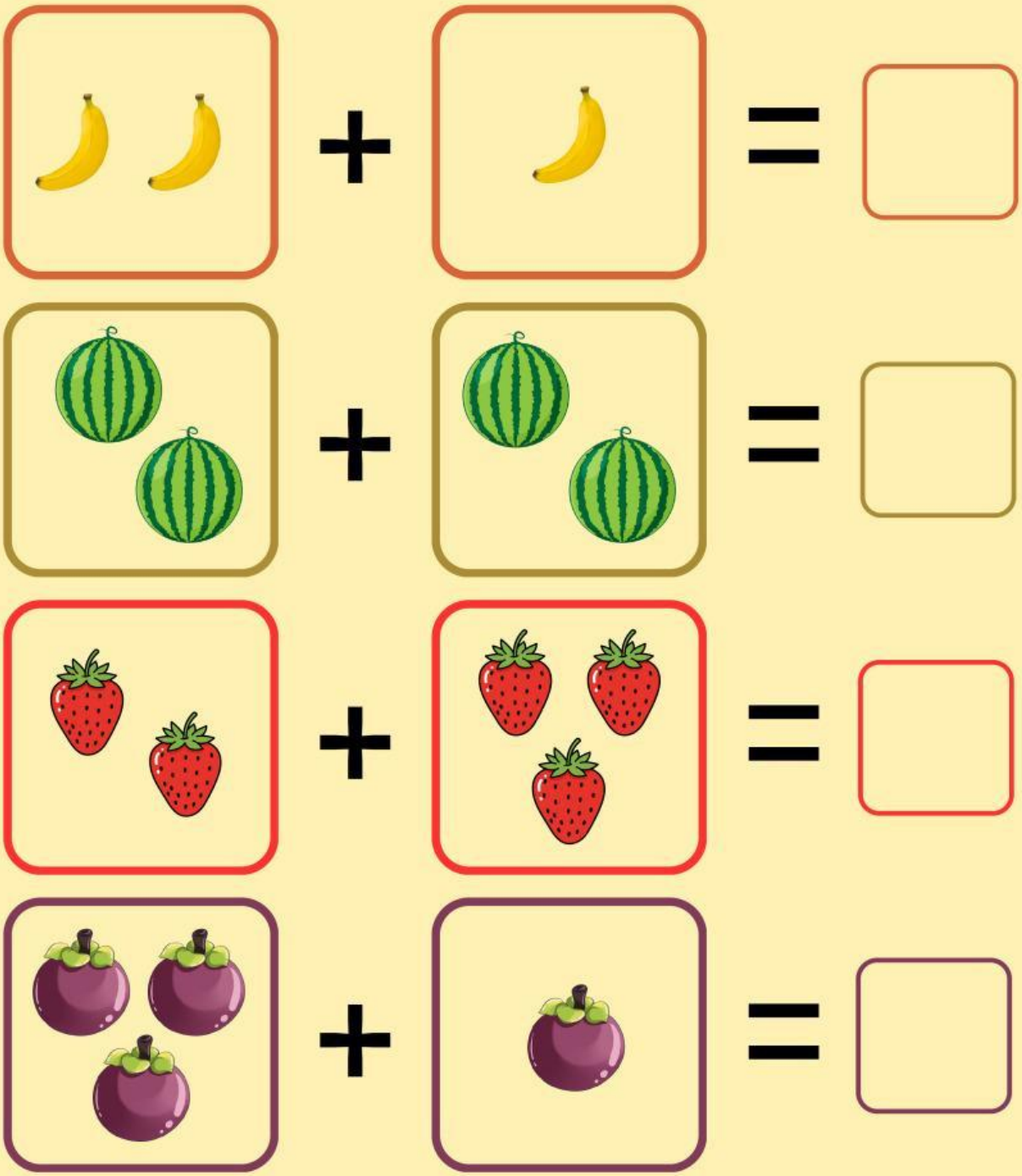

LIVEWORKSHEETS

PENGURANGAN

Kelas 1 SD

Nama: _____

Kelas: _____

Hitunglah pengurangan gambar berikut!

−

=

−

=



−

=



−

=

LIVEWORKSHEETS