Есімі Күні



КӨБЕЙТУ КЕСТЕСІ

6-ҒА

5. Суреттегі заттарды санап, мысалдарды толықтыр.



6 = 6 × _



6 + 6 = 6 × _



6 + 6 + 6 = 6 × _

6. 6 санына көбейтінді сандарды тап:

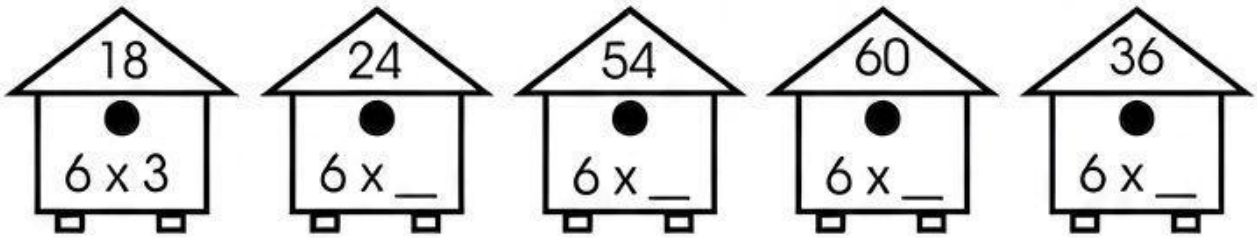

7. Ұяшықтарды толтыр:

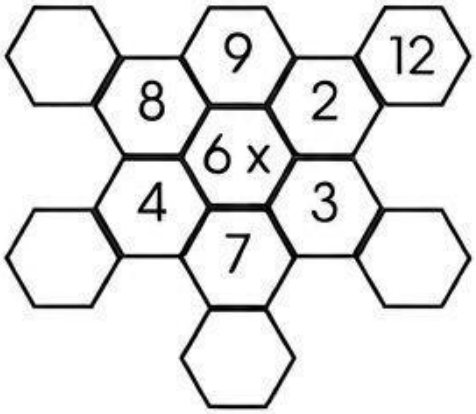

LIVEWORKSHEETS