On My Own

Name _____

1. How long is the toy truck?

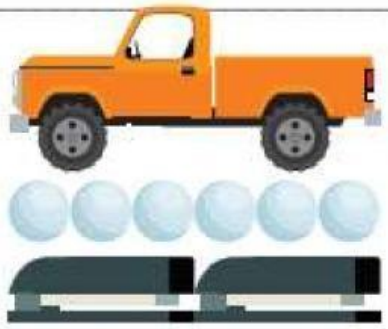

_____ golf balls

_____ staplers

2. How long is the toy boat?

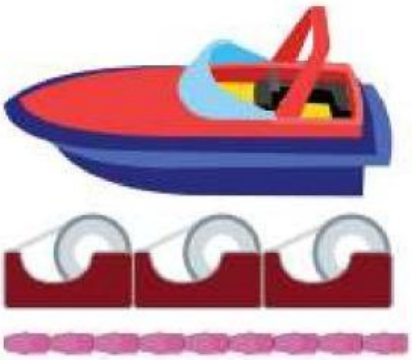

_____ tape holders

_____ erasers

How can you use two different units to measure the toothpaste tube?

3. Which unit is smaller?

A. dimes B. squares

4. Will you use *more* or *fewer* dimes than squares to measure the toothpaste?

_____ dimes than squares

Copyright © McGraw-Hill Education

LIVEWORKSHEETS

5. Will you use *more* or *fewer* keys than connecting cubes to measure the sandal? Explain.

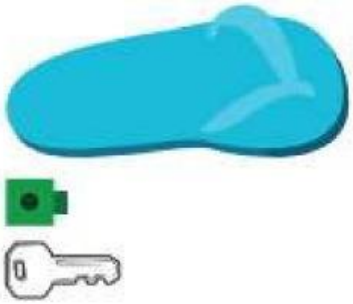

_____ keys than connecting cubes

6. **Extend Your Thinking** Choose two units to use to measure the length of your book. Which unit will you use more of to measure your book? Explain.

Reflect

How can you know which unit you will use *more* or *fewer* of to measure length?

Math is... Mindset

What helped you be ready to learn?

Copyright © McGraw-Hill Education

LIVEWORKSHEETS