LKPD

Matematika

Tema:

Bangun Datar

Nama:

Kelas:

LIVEWORKSHEETS

Bangun Datar

Tulislah nama-nama bangun datar di bawah ini.



LIVEWORKSHEETS

Ciri-ciri Bangun Datar

Hubungkan gambar dengan ciri-cirinya.











6 sisi

5 sisi

3 sisi

garis lengkung

4 sisi

LIVEWORKSHEETS

Mencari Bangun Datar

Lingkari bangun datar yang sejenis.

Bentuk lengkung



Segi empat





Segitiga



LIVEWORKSHEETS