3. Hitunglah keliling bangun datar berikut! **((Ketikkan jawaban ananda pada kotak hijau yang tersedia di samping soal)**

a.

cm

b.

cm

c.

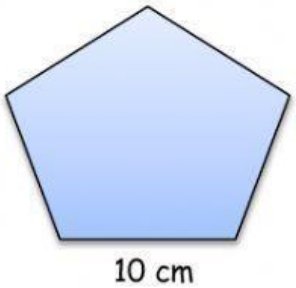

cm

d.

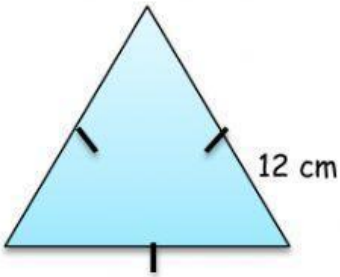

cm

e.

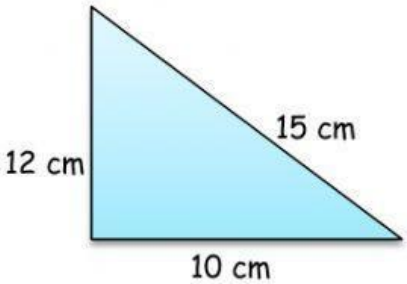

cm

4. Rendra membeli lukisan yang panjangnya 60 cm dan lebarnya 30 cm. Berapakah keliling lukisan ynag dibeli Rendra?

LIVEWORKSHEETS