3º ANO

MATEMÁTICA

RUBRICA :

Nome : _____

Data : ___/___/____

INFORMAÇÃO : _____

ANTES E DEPOIS

1 – **Desenha os ponteiros dos relógios que não os têm.**

15 MINUTOS ANTES





15 MINUTOS DEPOIS



45 MINUTOS ANTES





45 MINUTOS DEPOIS



30 MINUTOS ANTES





30 MINUTOS DEPOIS



5 MINUTOS ANTES





5 MINUTOS DEPOIS



LIVEWORKSHEETS