LKPD
MATEMATIKA

Kelas 3 Sekolah Dasar

Nama: **Kelas:**

LIVEWORKSHEETS

PENGURANGAN

Hitung objek lalu tulis jumlahnya setelah dikurangi!

3

LIVEWORKSHEETS

MELENGKAPI ANGKA YANG HILANG

Lengkapi deretan angka berikut dengan urutan angka yang benar!



LIVEWORKSHEETS

MENCOCOKKAN DENGAN GAMBAR JARI TANGAN

Hitung jumlah benda, lalu hubungkan ke gambar jari tangan yang menunjukkan jumlah itu.

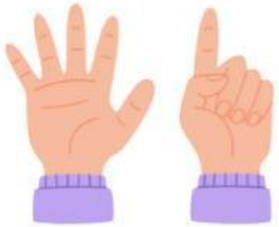

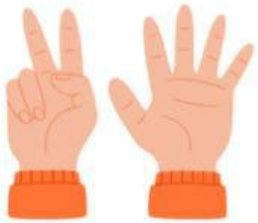



7

9

8

10

6

LIVEWORKSHEETS