Example

Count each group.

5 + 3

Count how many in all.

5 + 3 = 8 in all

Add

Write the sum.

1. 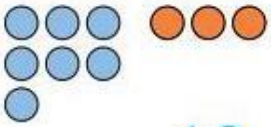

   7 + 3 = 10

2. 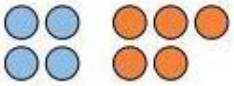

   4 + 5 = _____

3. 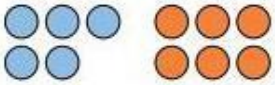

   5 + 6 = _____

4. 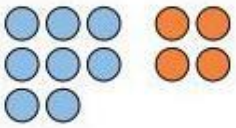

   8 + 4 = _____

5. 

   6 + 1 = _____

6. 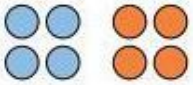

   4 + 4 = _____

LIVEWORKSHEETS