Nama :

Bentuk Aljabar

Yok,lengkapi kotak dibawah dan isi kotak tersebut dengan bentuk aljabar.

: p

: q

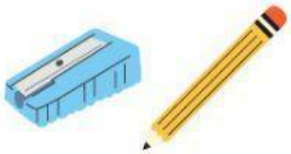

p + q





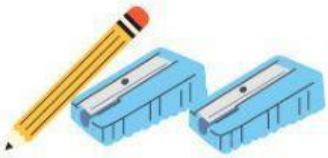

LIVEWORKSHEETS

ALJABAR MATH



Jodohkanlah bentuk aljabar ini dengan gambar sebelah kiri

$2x + 3y$	○	○	
$x + 3y$	○	○	
$x + y$	○	○	
$3x + 2y$	○	○	
$2x + 2y$	○	○	

: x

 : y

LIVEWORKSHEETS

Mari beri nama bentuk aljabar dibawah ini sesuai dengan unsur bentuk aljabar

2a

3b

5

LIVEWORKSHEETS