Work It Out

1. Put 24 oranges equally into 4 baskets. How many oranges are there in each basket?



$24 \div 4 =$

There are oranges in each basket.

2. Share 50 stickers equally among 5 children. How many stickers does each child get?



$50 \div 5 =$

Each child gets stickers.

LIVEWORKSHEETS

3. Pour 100 g of salt equally into 10 bowls. How many grams of salt are there in each bowl?



100 ÷ 10 = ☐

There are ☐ g of salt in each bowl.

4. 80 chairs are arranged equally in 10 rows. How many chairs ar there in each row?



☐ ÷ ☐ = ☐

There are ☐ chairs in each row.

LIVEWORKSHEETS

Worksheet 7 Word problems

1. Ahmad caught 20 fish. He put 4 fish in each plastic bag. How many plastic bags did he use?

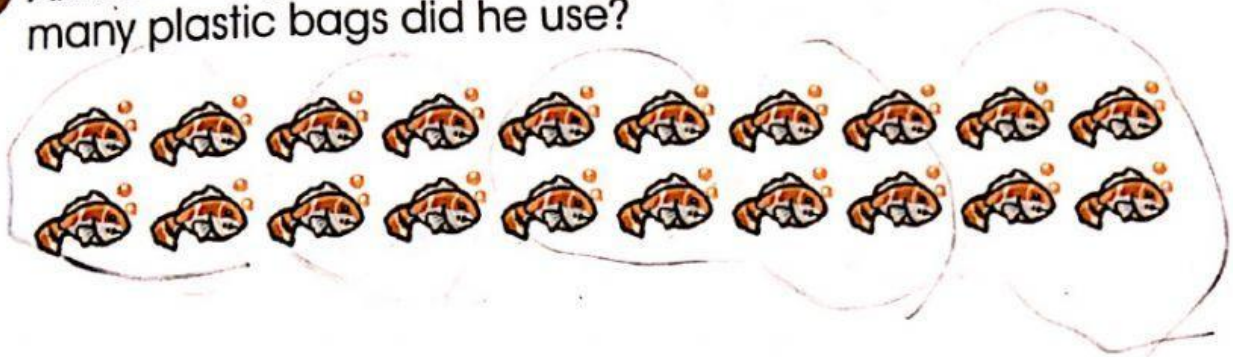

20 ÷ 4 = ☐

He used ☐ plastic bags.

2. Pei Pei bought 15 sweets for her 5 friends. Each of her friends got an equal number of sweets. How many sweets did each friend get?

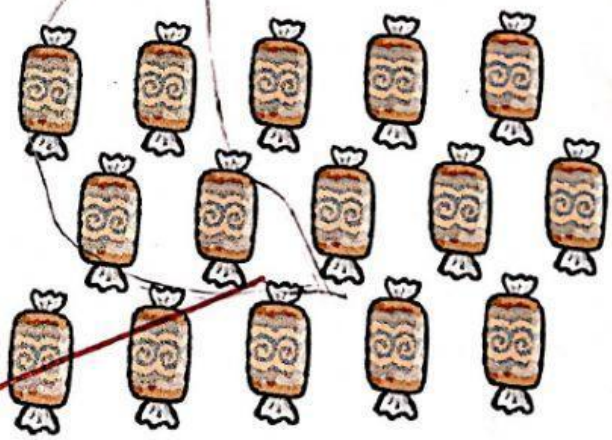

☐ ÷ ☐ = ☐

Each friend got ☐ sweets.

LIVEWORKSHEETS



There are [ ] birds on each tree.

4 Lisa had 20 cherries. She put 5 cherries on each cake she baked. How many cakes did she bake?



She baked [ ] cakes.

LIVEWORKSHEETS

5 Mr Ang puts 10 pens ... many boxes does he need to put 20 pens?

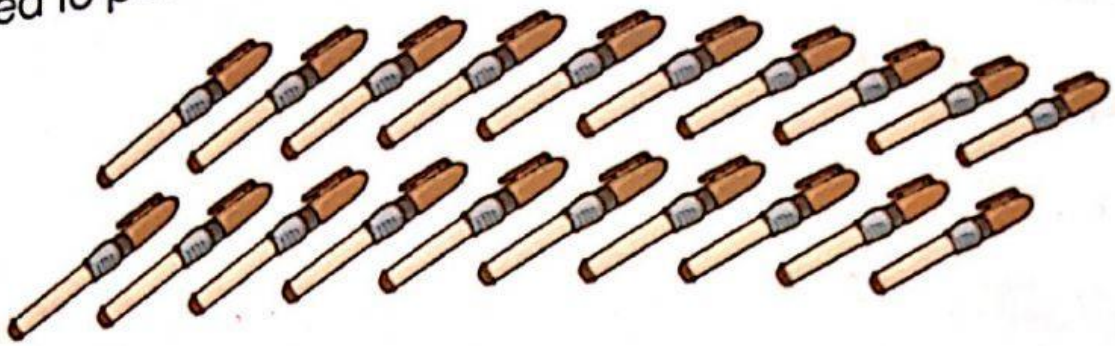

He needs [ ] boxes to put 20 pens.

6 Miss Kumar used 40 m of ribbon to tie 10 gift hampers. She used the same length of ribbon for each hamper. How many metres of ribbon did she use for each hamper?

She used [ ] m of ribbon for each hamper.

LIVEWORKSHEETS