تدرّب

ضَعْ على كُلِّ عُنْصُرٍ مَجْهولٍ اسْمَ الكَسْرِ مِنَ الكُلِّ الّذي يُمَثِّلُهُ.

4.

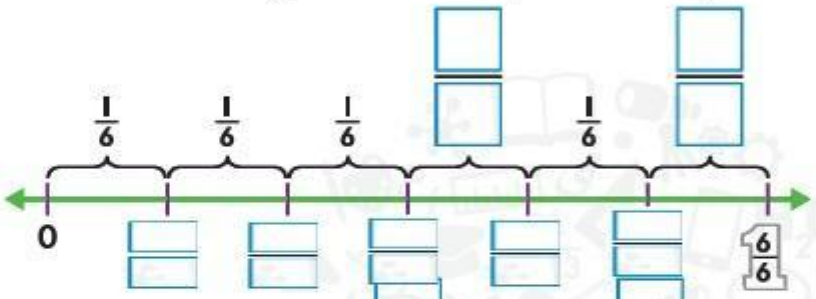

5.

سَمِّ الكُسورَ على خَطِّ الأَعْدادِ بَيْنَ 0 و 1.

6.

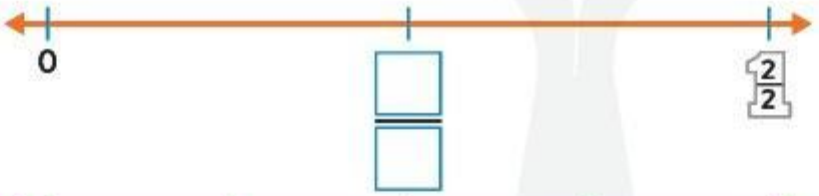

7.

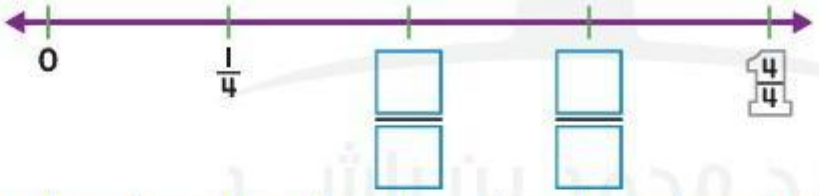

8.

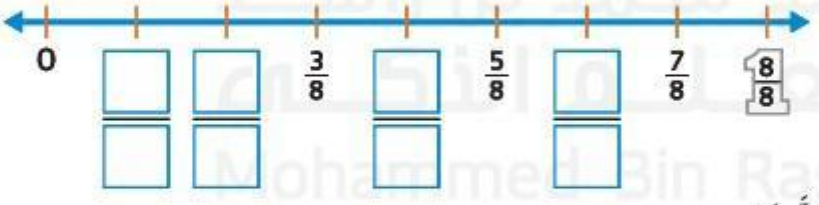

اُكْتُبِ النُّقْطَةَ الّتي تُمَثِّلُ كُلَّ كَسْرٍ.

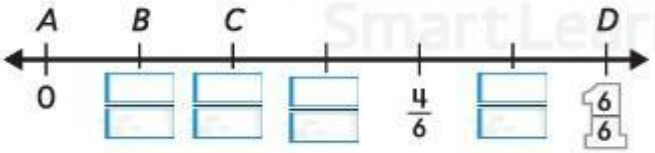

9. $\frac{2}{6}$ تُمَثِّلُهُ النُّقْطَةُ ____ .

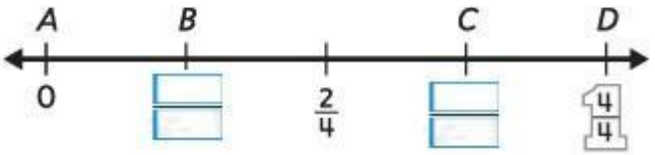

10. $\frac{4}{4}$ تُمَثِّلُهُ النُّقْطَةُ ____ .

LIVEWORKSHEETS