Name:_____

Ordering Numbers

Rewrite each list of numbers in order, from least to greatest.

a. 115 121 119 125 _____, _____, _____, _____

b. 423 432 342 344 _____, _____, _____, _____

c. 757 755 577 79 _____, _____, _____, _____

d. 210 340 304 200 _____, _____, _____, _____

e. 160 60 163 130 _____, _____, _____, _____

f. 445 145 545 454 _____, _____, _____, _____

LIVEWORKSHEETS

LIVEWORKSHEETS

What is the fraction of the shaded part?

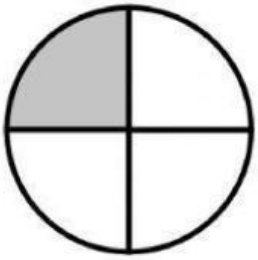 $\frac{1}{4}$	 _____
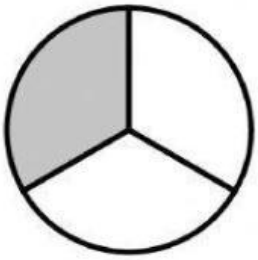 _____	 _____
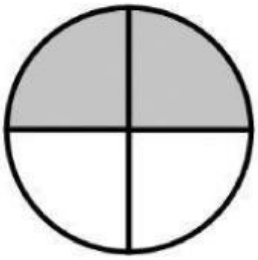 _____	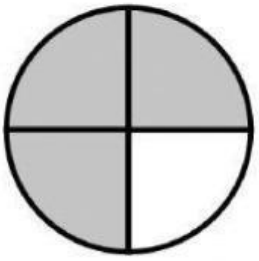 _____
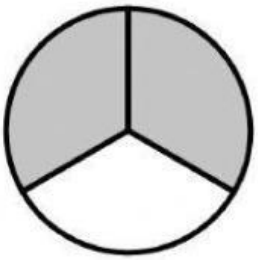 _____	 _____
 _____	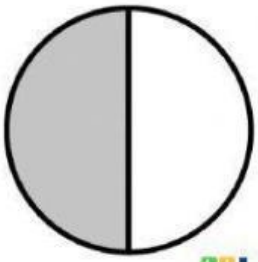 _____

LIVEWORKSHEETS

LIVEWORKSHEETS