Count the number of each item and write the number in the box.

1. 

2. 

3. 

4. 

5.

19 16 17 20 18

LIVEWORKSHEETS