Lembar Kerja Peserta Didik

Bidang Studi : Matematika

Gambarlah waktu sesuai dengan kegiatan!

Nama : _____



Belajar di rumah pukul 04.00 sore



Bermain di rumah pukul 03.00 sore



Makan siang pukul 12.00 siang



Mandi sore pukul 05.00 sore



Pergi ke sekolah pukul 07.00 pagi



Bangun pagi pukul 06.00 pagi



Tidur malam pukul 09.00 malam

LIVEWORKSHEETS