Họ và tên:_____ Ngày:_____

1. Thực hiện phép trừ

1)

9 – 3 = _____

2)

5 – 3 = _____

3) 

10 – 3 = _____

4)

6 – 3 = _____

5)

4 – 3 = _____

6)

8 – 3 = _____

LIVEWORKSHEETS

2. Viết phép tính trừ tương ứng với hình:

5 – 2 = ☐

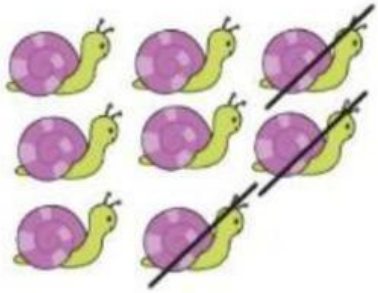

☐ – ☐ = ☐



☐ – ☐ = ☐

☐ – ☐ = ☐

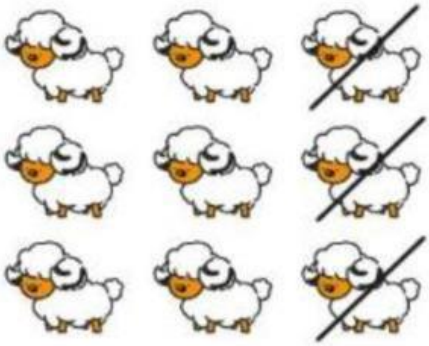

☐ – ☐ = ☐



☐ – ☐ = ☐

LIVEWORKSHEETS