GEOMETRIA

1.Clasifica los ángulos según sus medidas:

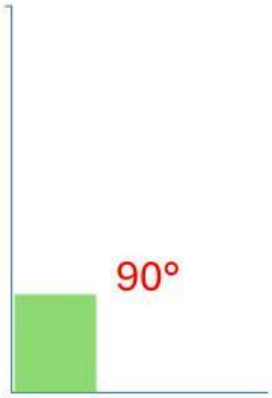

_____

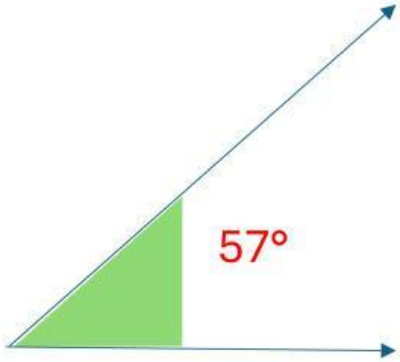

_____

_____



_____

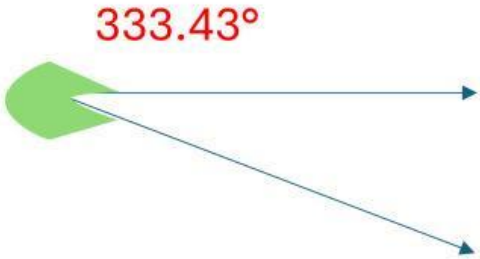

_____

_____

LLANO	**OBTUSO**	**CÓNCAVO**	**RECTO**	**COMPLETO**
AGUDO				

LIVEWORKSHEETS