Kangourou Italia
Gara del 18 marzo 2021
Categoria Ecolier
Per studenti di quarta o quinta della scuola primaria

ECOLIER

I quesiti dal N. 1 al N. 8 valgono 3 punti ciascuno

1. Enrico ha i 4 mattoni, identici per dimensioni, che vedi in figura:

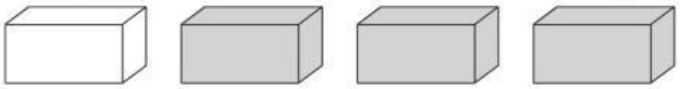

Quale dei cubimostrati quisotto puòcomporre ?

A) 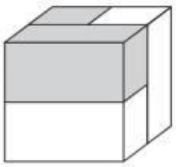 **B)** 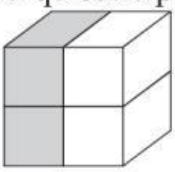 **C)** 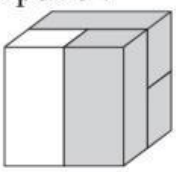 **D)** 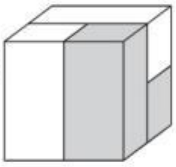 **E)** 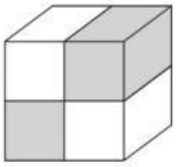

2. Se tendiamo la fune, quanti pesci risultano avere il muso rivolto verso l'anello?

A) 3 **B)** 5 **C)** 6 **D)** 7 **E)** 8

3. Incastrando le quattro tessere del puzzle in modo corretto, si ottiene un rettangolo in cui si legge un'addizione. Qual è il suo risultato?



A) 6 **B)** 15 **C)** 18 **D)** 24 **E)** 33

4. Alessia ha disegnato il sole sorridentechevedi qui a lato.
Quale dei seguenti frammenti fapartedelsuodisegno?



A) **B)** **C)**

D) **E)**

LIVEWORKSHEETS