Hallar las áreas de las figuras

Envía los resultados al correo indicado, sólo envíalo una vez, de hacerlo más veces se bajará calificación (cesar.cardoso@esipedu.com)

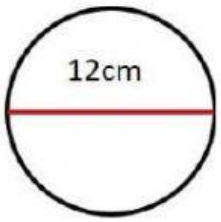	
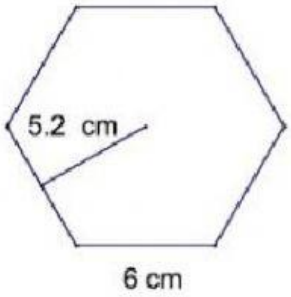	
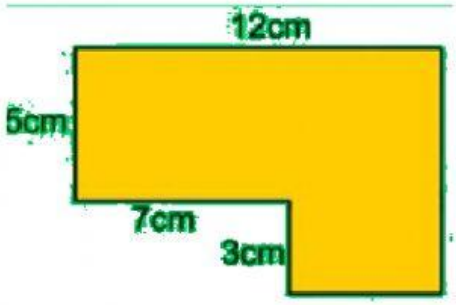	
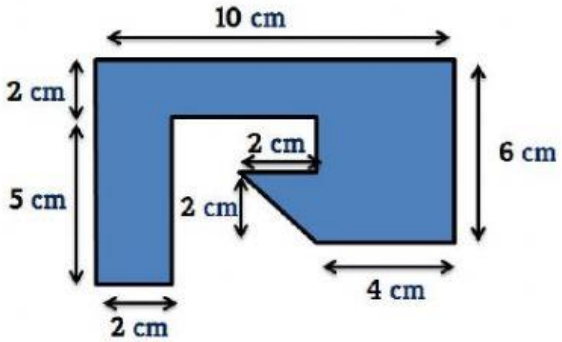	

$A = 48\ cm^2$

$A = 93.6\ cm^2$

$A = 113.04\ cm^2$

$A = 75\ cm^2$

LIVEWORKSHEETS