LKPD

ILMU PENGETAHUAN ALAM

Tema: Sistem Ekskresi Manusia

Nama: _____

Kelas: _____

LIVEWORKSHEETS

LEMBAR KERJA 1 – KENALI ORGAN EKSKRESI

1

Amati gambar organ ekskresi manusia berikut ini! Tuliskan nama organ yang ditunjuk sesuai dengan penanda.

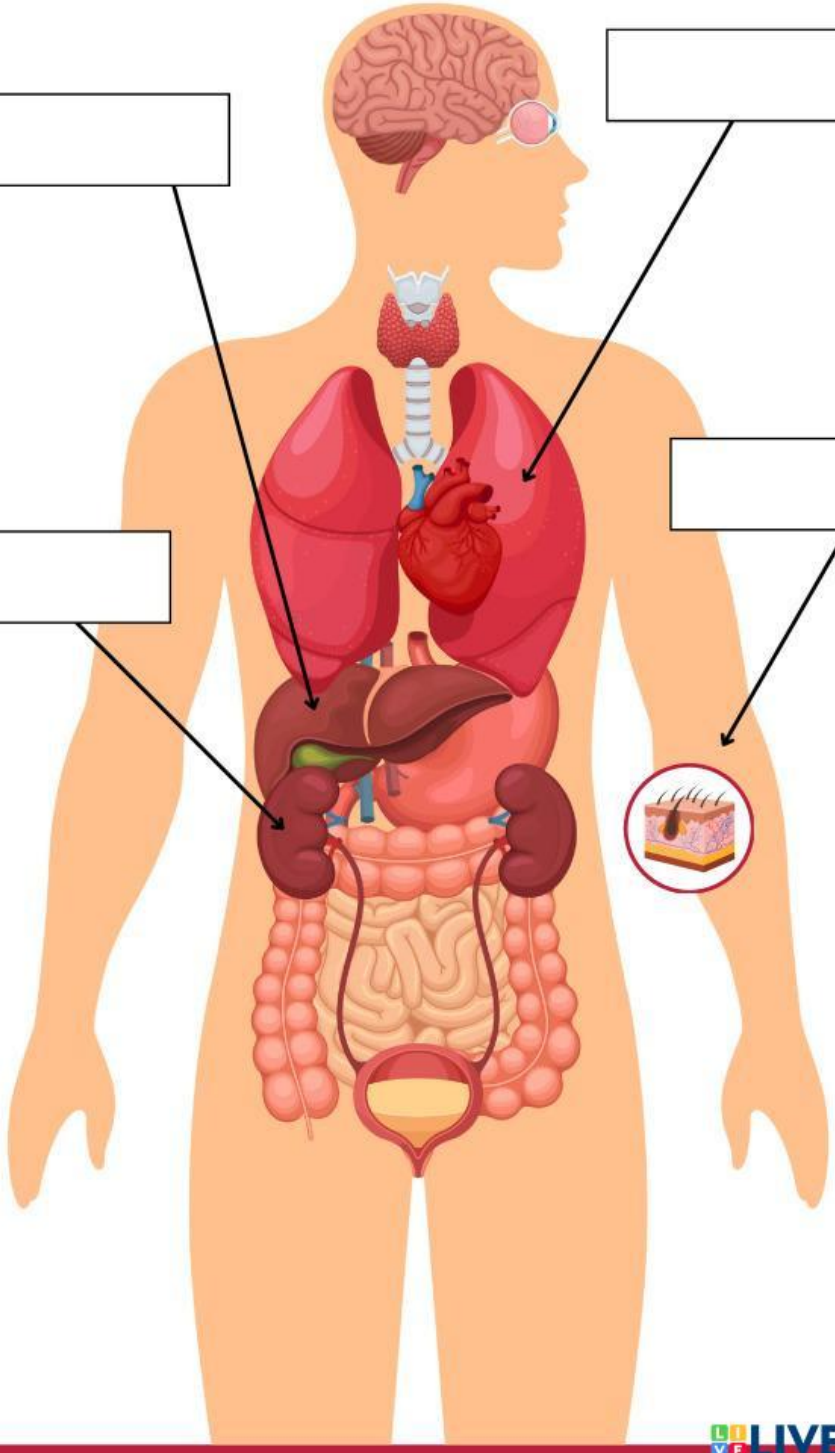

LIVEWORKSHEETS

LEMBAR KERJA 1 – KENALI ORGAN EKSKRESI

2

Amati gambar organ ekskresi manusia berikut ini! Tuliskan nama organ dan zat yang dikeluarkannya.

Gambar Organ	Nama Organ	Zat yang Dikeluarkan
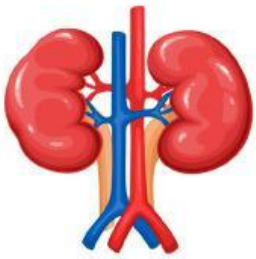		
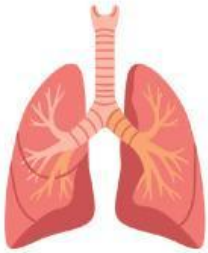		
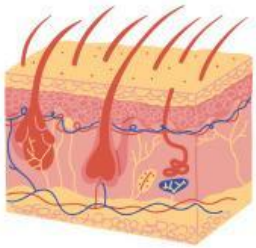		
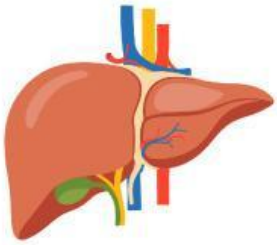		

LIVEWORKSHEETS

LEMBAR KERJA 2 – KENALI ORGAN EKSKRESI GINJAL

3 Isilah nama bagian tersebut !

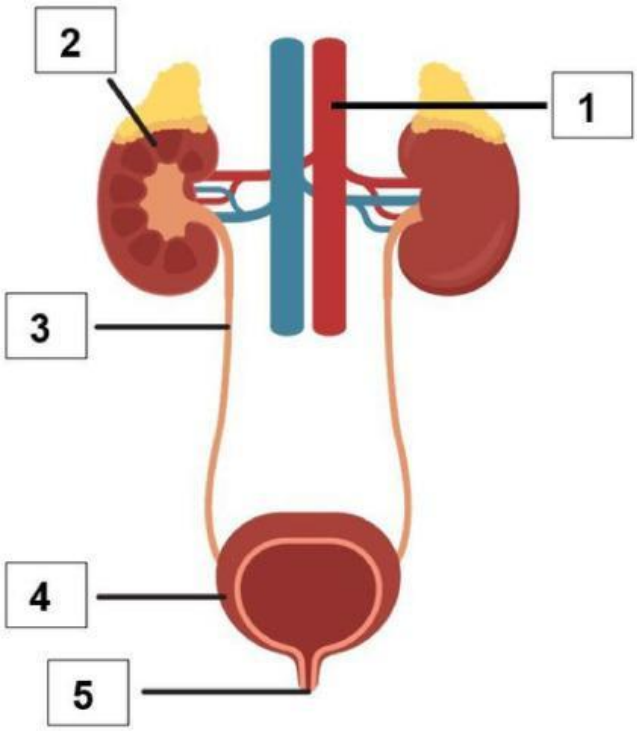

Kandung Kemih	Uretra	Pembuluh Darah
Ureter	Ginjal	

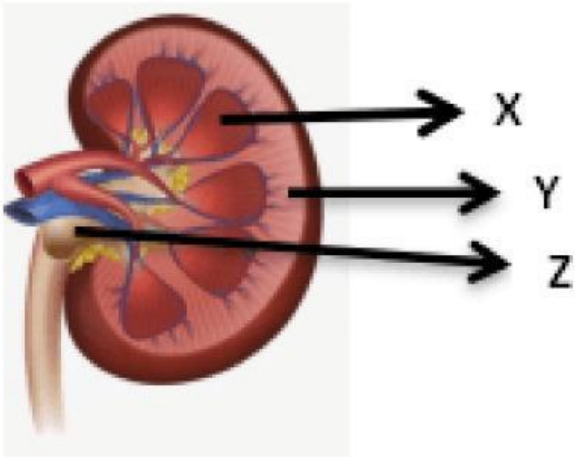

Pelvis	Medula	Korteks

LIVEWORKSHEETS

LEMBAR KERJA 3 – PROSES PEMBENTUKAN URINE

4 Isilah nama bagian-bagian nefron dibawah ini !

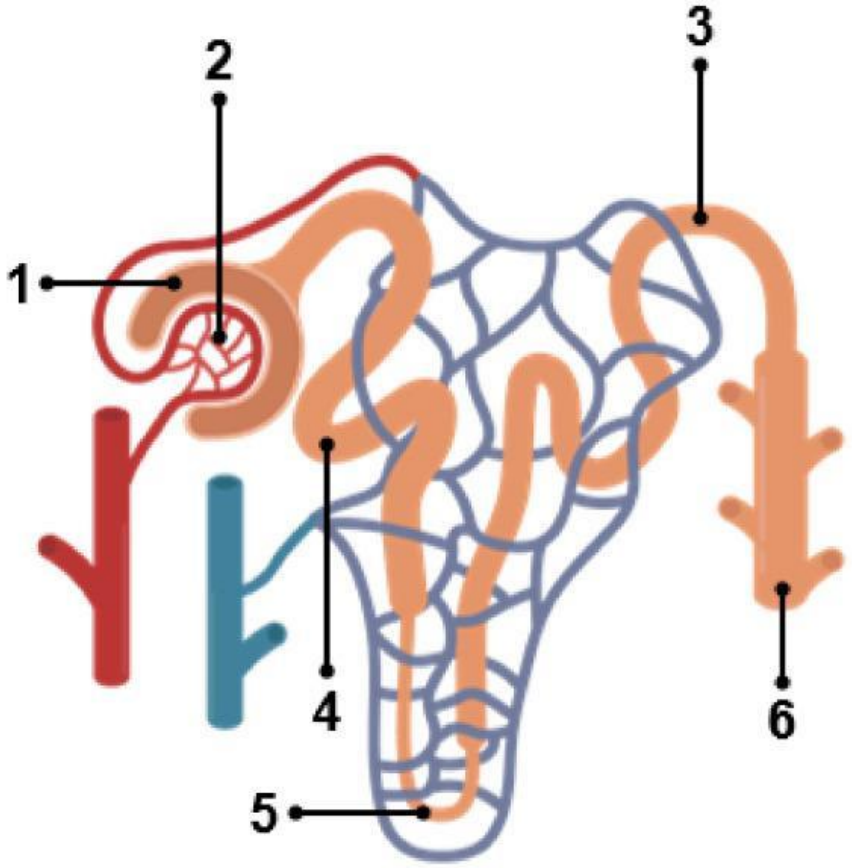

No	Proses	Tempat	Deskripsi	Hasil

LIVEWORKSHEETS

LEMBAR KERJA 4 – KENALI ORGAN EKSKRESI HATI & KULIT

5 Isilah nama bagian-bagian hati dan kulit dibawah ini !

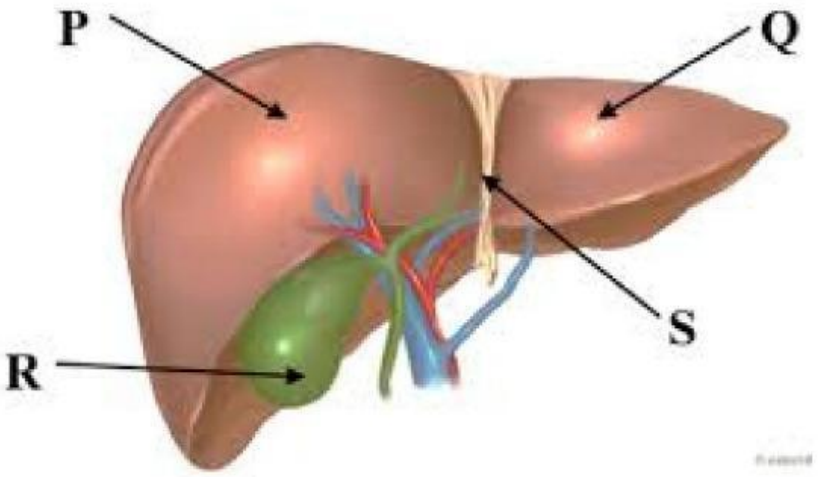

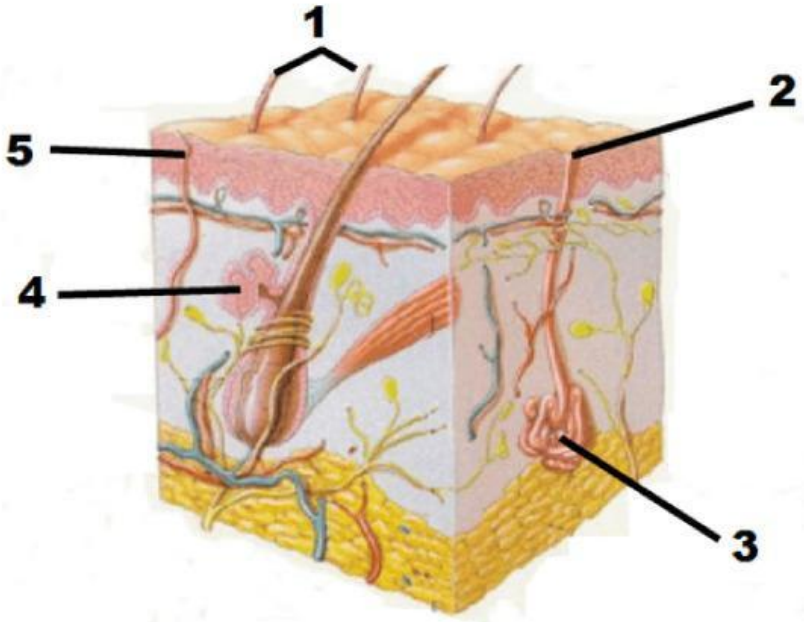

LIVEWORKSHEETS

LEMBAR KERJA 5 – PROSES EKSKRESI DALAM TUBUH

6 Berilah tanda centang terkait fungsi organ hati yang benar (jawaban bisa lebih dari satu)

- ○ Menghasilkan empedu
- ○ Menetralkan racun (detoksifikasi)
- ○ Menjaga suhu tubuh
- ○ Merombak sel darah merah

7 Lengkapi bagan proses perombakan sel darah merah di hati !

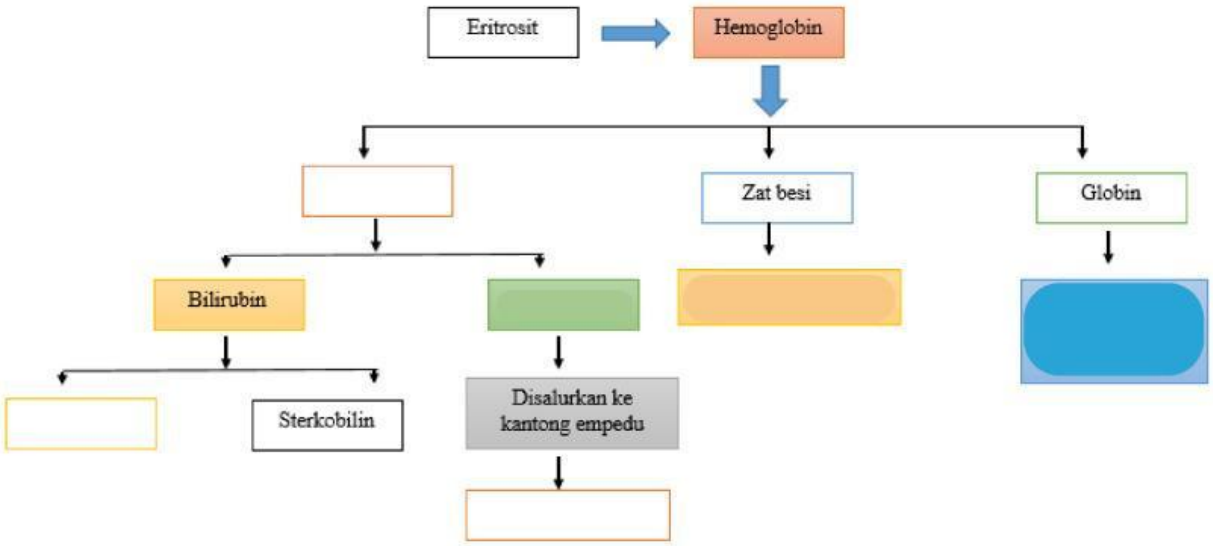

LIVEWORKSHEETS

LEMBAR KERJA 5 – PROSES EKSKRESI DALAM TUBUH

8 Jelaskan bagaimana proses osmoregulasi antara kulit dengan ginjal !

LIVEWORKSHEETS