Circunferencia

Observa los círculos y calcula cuanto mide la circunferencia de cada uno. Utilizando la formulas, **D x π o 2 r x π**

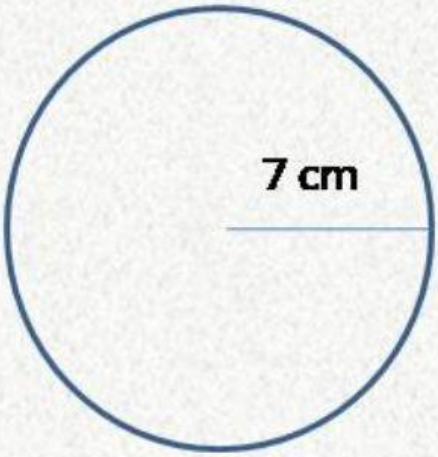

Longitud de circunferencia:

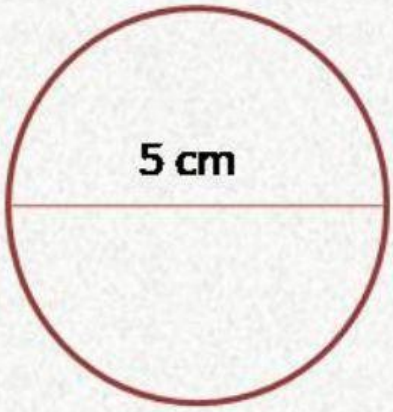

Longitud de circunferencia:

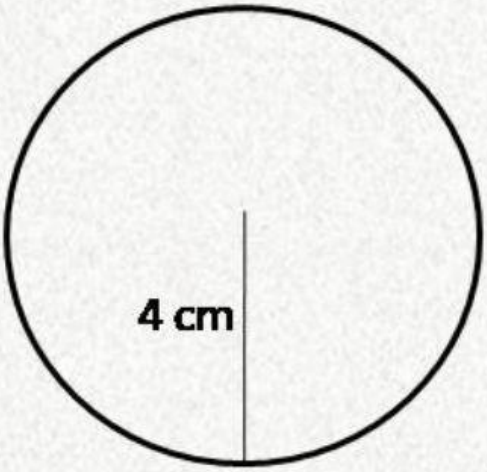

Longitud de circunferencia:

REUERDA π
VALE 3.1416

LIVEWORKSHEETS