Lembar Kerja Peserta Didik

LKPD

BANGUN DATAR SEGITIGA

Disusun oleh : Rindu Kusumaningtyas

NIM : 34302400145

LIVEWORKSHEETS

Nama :

Kelas :

Ciri-ciri Bangun Datar

Tariklah garis untuk menghubungkan bangun datar dengan ciri-cirinya dengan tepat dan benar!

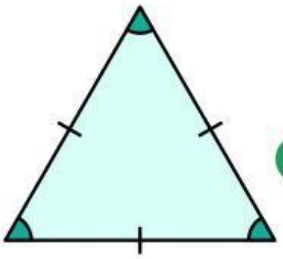

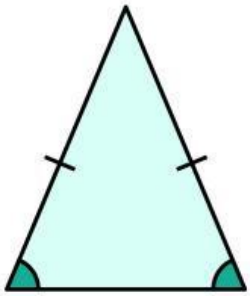

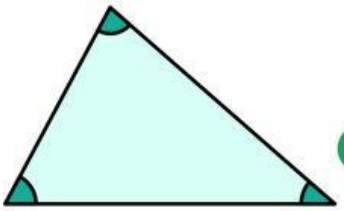

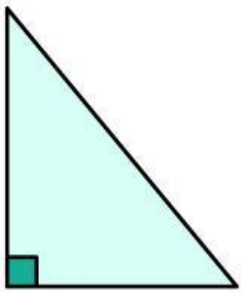

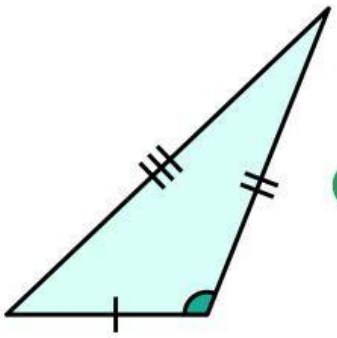

Segitiga dengan 1 sudut 90°

Segitiga dengan 2 sisi sama panjang

Segitiga dengan 1 sudut tumpul (> 90°)

Segitiga dengan 3 sisi sama panjang

Segitiga dengan 3 sisi berbeda panjang

LIVEWORKSHEETS

Nama :

Kelas :

Keliling Segitiga

Perhatikan gambar bangun datar segitiga berikut dan hitunglah kelilingnya dengan benar dan tepat!

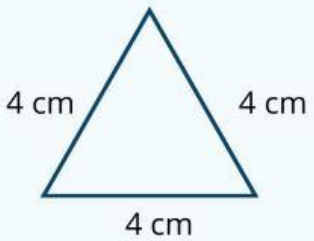

Keliling = 4 + 4 + 4

Keliling = 12 cm

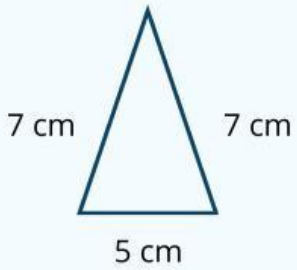

Keliling = ... + ... + ...

Keliling = ... cm

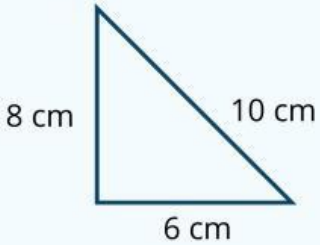

Keliling = ... + ... + ...

Keliling = ... cm

Keliling = ... + ... + ...

Keliling = ... cm

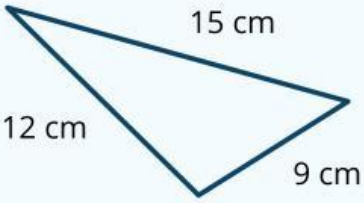

Keliling = ... + ... + ...

Keliling = ... cm

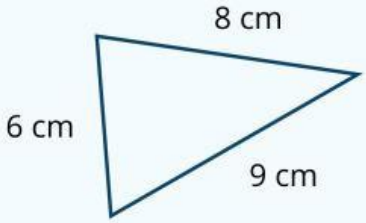

Keliling = ... + ... + ...

Keliling = ... cm

LIVEWORKSHEETS