عزيزتي الطالبة : وفقي بين كل اقتران و تمثيله البياني من خلال سحب القاعدة و وضعها بجانب الاقتران المناسب لها
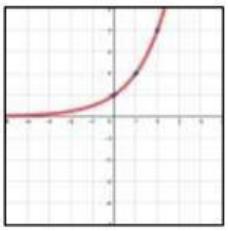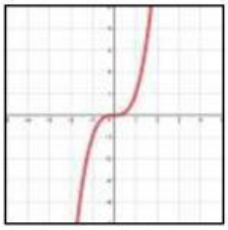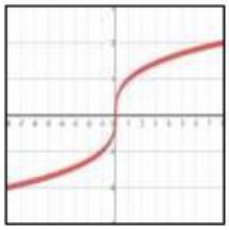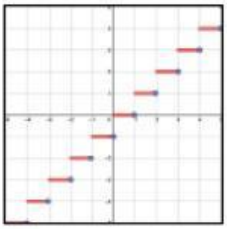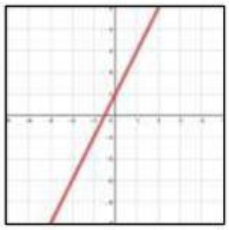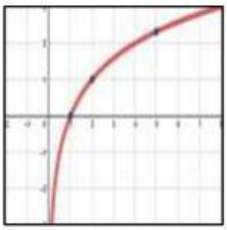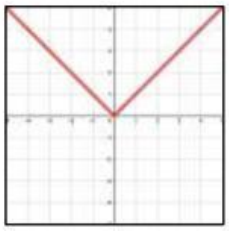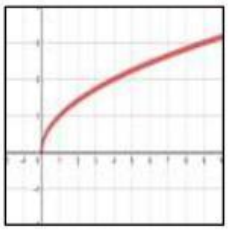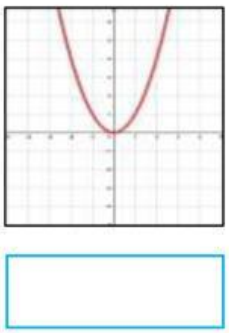
ق(س) = ٣	ق(س) = |س|	ق(س) = [س]	ق(س) = س ^٣^	ق(س) = √س
ق(س) = س ^٢^	ق(س) = ٢س + ١	ق(س) = ∛س	ق(س) = ٢ ^س^	ق(س) = لـو ^٢^ س