Lembar Kerja Peserta Didik

LKPD Matematika

SIMETRI

Nama : _____

Kelas : _____

LIVEWORKSHEETS

SIMETRI LIPAT DAN SIMETRI PUTAR

Hitunglah banyaknya simetri lipat dan putar dari bangun di bawah ini!

Persegi	Persegi Panjang	Belah Ketupat
		
Simetri lipat = _____ Simetri putar =_____	Simetri lipat = _____ Simetri putar =_____	Simetri lipat = _____ Simetri putar =_____
Segi Lima	**Segi tiga**	**Trapesium**
	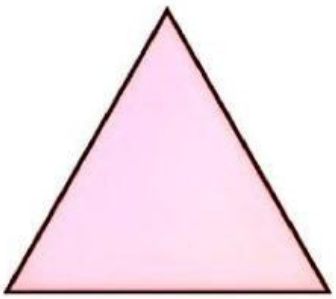	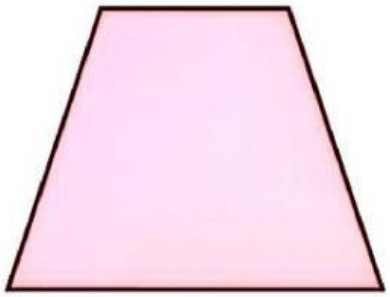
Simetri lipat = _____ Simetri putar =_____	Simetri lipat = _____ Simetri putar =_____	Simetri lipat = _____ Simetri putar =_____

LIVEWORKSHEETS

SIMETRI LIPAT

Gambarlah semua simetri lipat pada bangun datar berikut!

Contoh:

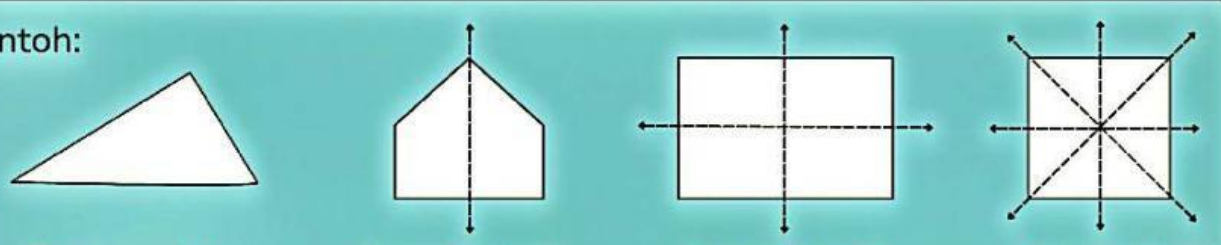

Tidak memiliki simpetri lipat | 1 simetri lipat | 2 simetri lipat | 4 simetri lipat

_____

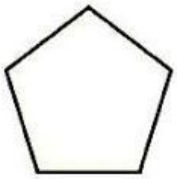

_____



_____

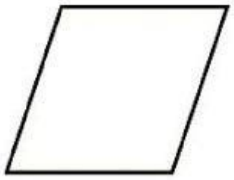

_____

_____



_____



_____

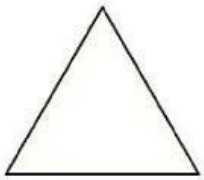

_____



_____

_____

_____

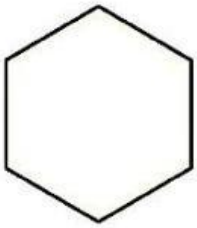

_____

LIVEWORKSHEETS