Miss. Patricia Cano

Music Class

Name: _____ Grade: _____

Rhythmic Dictation

Listen, drag and drop the notes
from the options given:



1.

2.

3.

Melodic Dictation

Match the melody with the sound



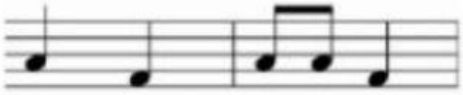

LIVEWORKSHEETS

Write the melodic dictation on the web page for free notation. Once you have finished, save the file as a PDF and upload it to Classroom. If you can not enter the Web page, write it on paper and upload it to Classroom:

Dictation:

The web page for free notation:

Click Here

Time Signatures

Drag the musical excerpts into the column with the correct time signature



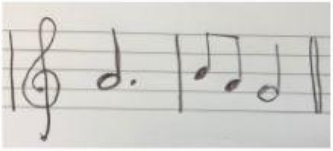













2/4 time	3/4 time	4/4 time

LIVEWORKSHEETS

C Scale

Write the name of each note using letters: A B C ....

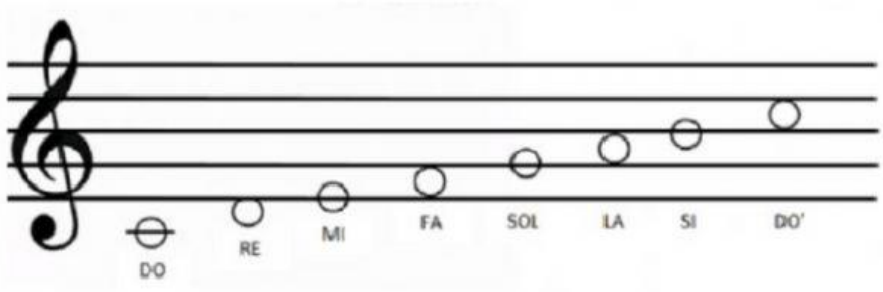

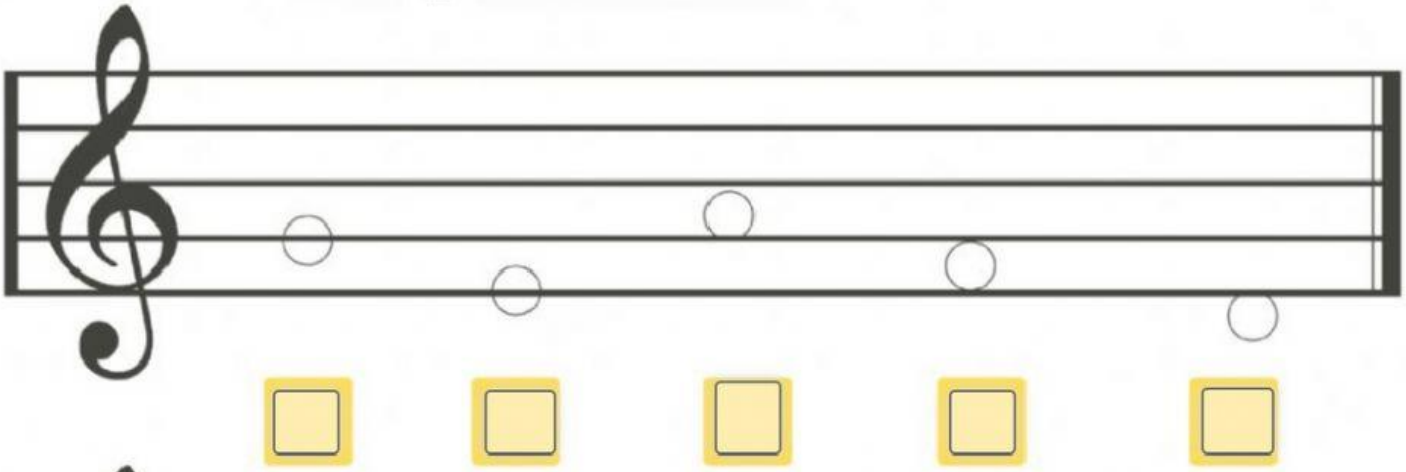

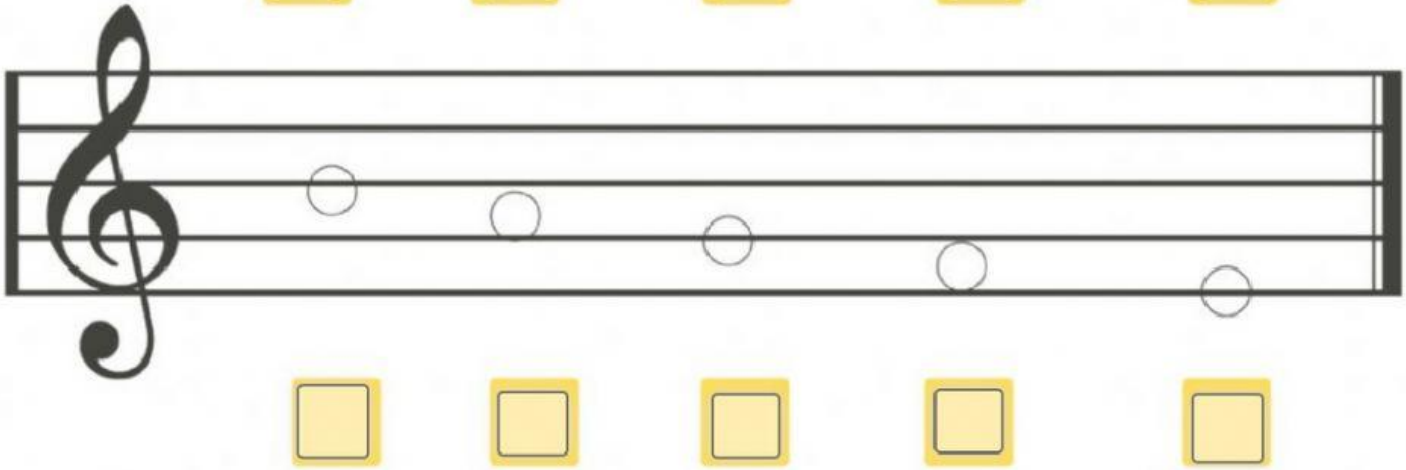

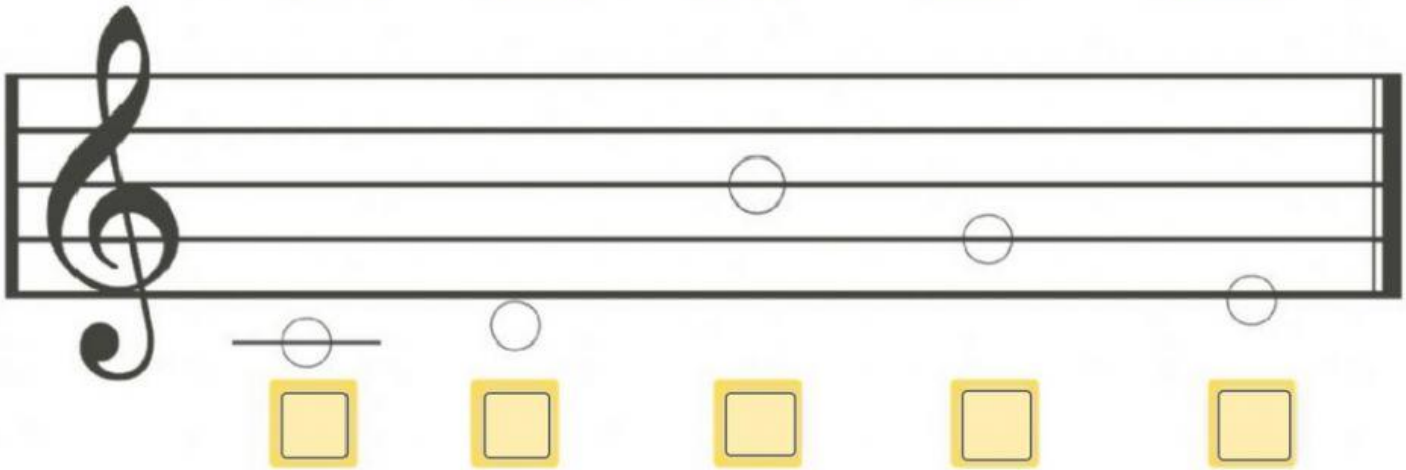

LIVEWORKSHEETS

Major Scales

Answer the next questions:

1. What is an interval:

2. What is the Major Scale's pattern of intervals:

a. **WWWHWHW**

b. **WWHWWWH**

c. **WHWHWHW**

d. **WWHWHWH**

3. Join the Key signature with the correct image:



D MAJOR

C MAJOR



G MAJOR

4. Write a composition of 10 measures. Time: 3/4.
Key signature: D major. Use only the notes of the chord.
(If you can not enter the Web page, write it on paper and upload it to Classroom)

The web page for free notation:

Click Here

LIVEWORKSHEETS

5. Use the piano Keyboard to answer the question:

Name the enharmonic equivalent of each note below

D*b* = _____ **F*b*** = _____ **B** = _____

E# = _____ **A*b*** = _____ **D#** = _____

G# = _____ **B#** = _____ **C** = _____

F# = _____ **B*b*** = _____ **C*b*** = _____

E*b* = _____ **A#** = _____ **F** = _____

E = _____ **G*b*** = _____ **C#** = _____

6. Identify Major triads. Write the name of the notes in the circles and provide the name of the chord:

: Chord of _____

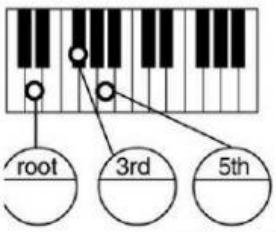

: Chord of _____

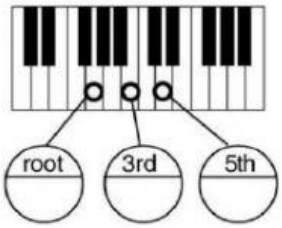

: Chord of _____

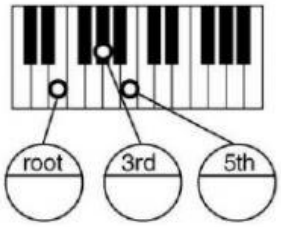

: Chord of _____

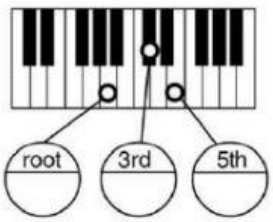

: Chord of _____

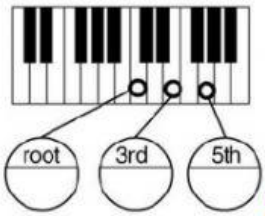

LIVEWORKSHEETS