I. jawablah dengan melingkari jawaban a,b,c atau d yang kamu anggap benar!

1. Berapa jumlah bintang disamping...

   a. 10 b. 9
   c. 8 d. 7

2. 22 Bilangan disamping dibaca.....
   a. dua pululh satu b. Dua puluh c. Dua puluh dua d. dua puluh tiga

3. Urutkan dari yang terkecil.....

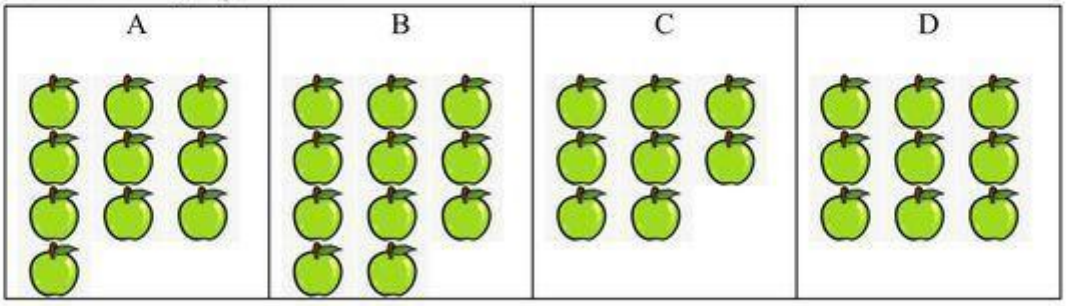

   a. b,c,a,d
   b. c,d,a,b
   c. d,c,a,b
   d. a,b,c,d

4. Lambang bilangan delapan adalah.....
   a. 9 c. 8
   b. 7. d. 10

5. 9 + 7 = ...
   a. 16 b. 17 c. 18 d. 19

6. 10 – 7 = ...
   a. 5 b. 4 c.3 d. 2

7. 2 + 4 + 3 = ...
   a. 9 b. 8 c. 7 d. 3

8. 6 ..... 9 , tanda yang tepat adalah
   a. < b > c. = d. +

9. Ibu membeli telur 10 butir di warung, ketika berjalan pulang telu tersebut pecah 5 butir, berapa sisa telur ibu.....
   a. 3 b. 4 c. 5 d. 6

10. Ani mempunyai pensil 3 buah, Tantri mempunyai pensil 6 buah. Berapa jumlah pensil Ani dan Tantri....
   a. 7 b. 8 c. 9 d. 10

LIVEWORKSHEETS

Nama: _____ Kelas: _____

Penjumlahan dan Pengurangan

3 + 5	●	●	27
12 + 4	●	●	77
13 + 14	●	●	8
25 + 24	●	●	16
44 + 33	●	●	49

9 – 3	●	●	22
16 – 5	●	●	26
35 – 13	●	●	37
48 – 22	●	●	11
67 – 30	●	●	3

LIVEWORKSHEETS

ใบงานที่ 11

หาผลลัพธ์การบวกและการลบต่อไปนี้

เริ่มตรงนี้

1	+	3	=					
					+			
	=	3	-			5	=	
+								+
4				=				
=				6	-		=	7
	-	10	=		+	11	=	
								-
15	-		=	24	+			16
=								=
					=	22	+	
+								
30	=		-	30	=			



LIVEWORKSHEETS

Aboutpreschool.net

Preschool Addition Worksheet
Matching

2+1	9
8+2	11
7+4	10
1+8	5
9+6	15
2+3	3
4+5	9

LIVEWORKSHEETS

Hitung dan Pasangkan

8



4



10



5



7



6

LIVEWORKSHEETS