ROYAL BRITISH INTERNATIONAL SCHOOLS

Math Placement Test

Grade(5-6)

Name:.....

40

Question One: (6Marks)

a. Write the place value of each underlined digit:

306,421..... 10,152.....

b. Write the following number in words:

582,000.....

.....

71,600.....

.....

c. Write the following in figures(Numbers):

Nine hundred thousand ..... six thousand fifty.....

Question (2): (18Marks)

a. Find out:

. 218,870 + 3,188 =	101,893 + 67,271 =	434,302 - 879,054=
.....	.....	.....
.....	.....	.....
.....	.....	.....
.....	.....	.....

LIVEWORKSHEETS

b. Find the Product of:

5,807 × 827=

.....

.....

.....

.....

.....

.....

7,725 × 328=

.....

.....

.....

.....

.....

.....

c. Divide:

3,515÷ 8= .....

5,134 ÷ 7= .....

d. work out:

0.17 + 1.8 = ...

1.5 + 0.13 =.....

e. There are 1,354 animals in one barn. There are 574 goats, 346 cows, and the rest are horses. If 89 horses were sold, how many horses are left in that barn?

.....

.....

.....

.....

LIVEWORKSHEETS

Question (3): (4Marks)

1) Circle the correct classification for the angle or angles shown:

1. a. complementary

b. straight

c. acute

d. right

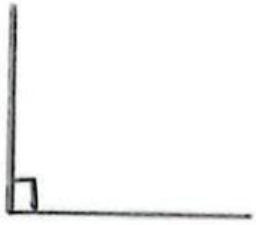

2. a. right

b. straight

c. acute

d. complementary



2) Find the perimeter and the area of this shape:

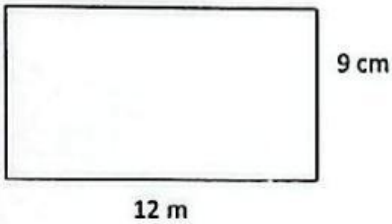

1) perimeter = ☐ area = ☐

Question (4): (12 Marks)

1) Find the answers to these fractions:

$\frac{7}{10} - \frac{2}{5} =$ .....

.....

$3\frac{8}{27} + \frac{5}{3} =$ .....

.....

LIVEWORKSHEETS

2) Find the sum:

73.84 + 82.86 =

.....

.....

.....

324.7 + 8.624 =

.....

.....

.....

3) Subtract.

$$\begin{array}{r} 670.56 \\ -\ 38.19 \\ \hline \end{array}$$

$$\begin{array}{r} 9653.0 \\ -\ 8496.4 \\ \hline \end{array}$$

LIVEWORKSHEETS