Radius and Diameter

What is the radius and diameter of each circle?

a.

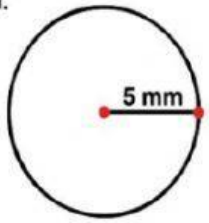

radius = _____

diameter = _____

b.

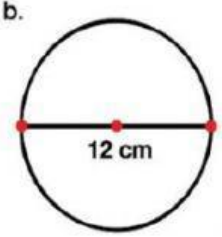

radius = _____

diameter = _____

c.

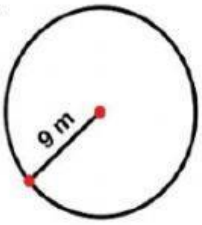

radius = _____

diameter = _____

d.

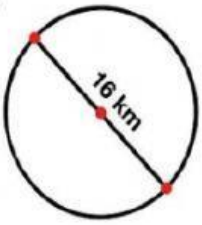

radius = _____

diameter = _____

e.

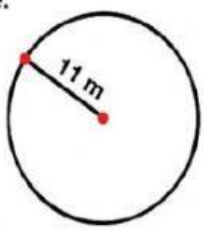

radius = _____

diameter = _____

f.

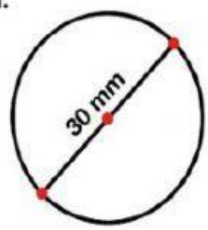

radius = _____

diameter = _____

g.

radius = _____

diameter = _____

n.

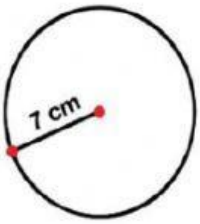

radius = _____

diameter = _____

i.

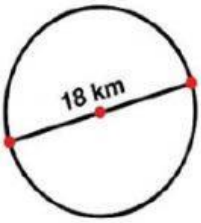

radius = _____

diameter = _____

j.

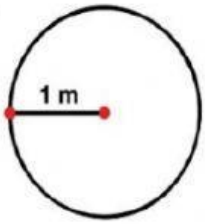

radius = _____

diameter = _____

k.

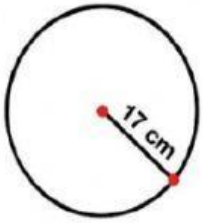

radius = _____

diameter = _____

l.

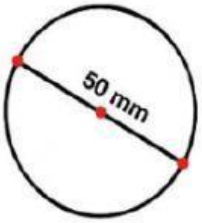

radius = _____

diameter = _____

m. John has a round swimming pool. The distance from the center of the pool to the edge is 3 meters. What is the diameter of John's pool?

answer: _____

LIVEWORKSHEETS