Ada berapa banyak?

Lingkari angka sesuai dengan jumlah sayur dan buah yang kamu lihat



1 2 4



3 2 6

2 3 8



3 4 2

LIVEWORKSHEETS