SMP Islam AL MUMTAAZ

PENILAIAN SUMATIF TENGAH SEMESTER

Nama :

Kelas :

Mengurutkan Bilangan Bulat

Urutkan bilangan bulat berikut dari yang terkecil!

1. 2, -1, 0, -2, 3, 1, -3 →
2. 8, -6, 12, -1, 0, -4, 10 →
3. 0, -25, 10, 1, -2, 43, -12 →
4. -67, 1, -25, 30, -1, 77, -5 →

Urutkan bilangan bulat berikut dari yang terbesar!

5. 2, 0, -1, 1, -3, 3, 2 →
6. 0, 7, -8, 5, -5, 10, -9 →
7. 5, -20, 21, 54, -6, 33,-1 →
8. -27, 78, 0, -1, -87, 29, 4 →

LIVEWORKSHEETS

PENJUMLAHAN BILANG BULAT

PETUNJUK : Bacalah soal di bawah ini dan jawablah dengan benar!

9. Bapak memiliki 50 kg beras di gudangnya. Ia membeli lagi 25 kg beras. Berapa total beras yang dimiliki Bapak?

10. Di sebuah kelas ada 35 siswa, dan di kelas sebelah ada 28 siswa. Berapa jumlah seluruh siswa di kedua kelas?

LIVEWORKSHEETS

Pengurangan Bilangan Bulat

Hitunglah operasi pengurangan bilangan bulat berikut dengan mengisi jawaban dengan tepat!

11.	2 - 6	=		19.	-5 - 2	=	
12.	-9 - (-6)	=		20.	-3 - 7	=	
13.	2 - (-1)	=		1.	7 - 1	=	
14.	-1 - 1	=		2.	0 - (-4)	=	
15.	5 - 6	=		3.	-6 - (-5)	=	
16.	7 - 7	=		4.	9 - 5	=	
17.	8 - 7	=		25	0 - 8	=	
18.	-1 - 1	=		26.	1 - 10	=	

LIVEWORKSHEETS

PECAHAN

Lingkari pecahan yang sesuai dengan bagian yang diarsir pada setiap bentuk dari pilihan yang tersedia.

27		$\frac{1}{6}$	$\frac{3}{4}$	$\frac{2}{4}$	$\frac{3}{6}$	$\frac{2}{6}$
28.		$\frac{2}{7}$	$\frac{3}{8}$	$\frac{4}{7}$	$\frac{1}{5}$	$\frac{5}{7}$
29.		$\frac{3}{5}$	$\frac{4}{5}$	$\frac{5}{6}$	$\frac{3}{5}$	$\frac{4}{6}$
30.		$\frac{6}{8}$	$\frac{5}{6}$	$\frac{6}{4}$	$\frac{5}{8}$	$\frac{4}{6}$
31.		$\frac{1}{6}$	$\frac{2}{6}$	$\frac{2}{7}$	$\frac{3}{6}$	$\frac{2}{5}$
32.		$\frac{3}{8}$	$\frac{2}{6}$	$\frac{3}{3}$	$\frac{2}{8}$	$\frac{3}{6}$
33.	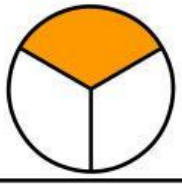	$\frac{1}{2}$	$\frac{2}{3}$	$\frac{1}{3}$	$\frac{2}{2}$	$\frac{2}{4}$
34.	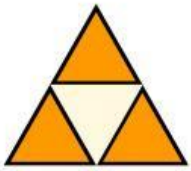	$\frac{3}{4}$	$\frac{1}{3}$	$\frac{2}{3}$	$\frac{2}{4}$	$\frac{3}{3}$
35.		$\frac{4}{8}$	$\frac{5}{7}$	$\frac{2}{8}$	$\frac{3}{7}$	$\frac{2}{7}$

LIVEWORKSHEETS

PENJUMLAHAN PECAHAN

Kerjakanlah operasi hitung pecahan berikut ini dengan tepat!

36. 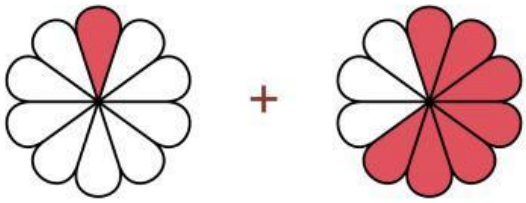 $+ \quad = \frac{\square}{\square} + \frac{\square}{\square} = \frac{\square}{\square}$

37. 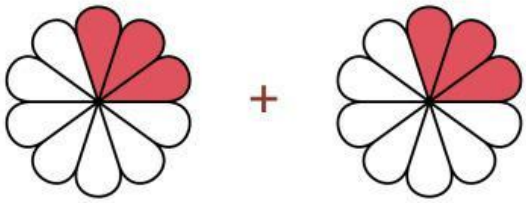 $+ \quad = \frac{\square}{\square} + \frac{\square}{\square} = \frac{\square}{\square}$

38. 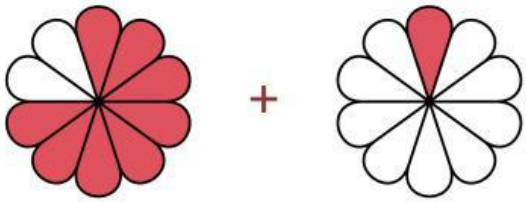 $+ \quad = \frac{\square}{\square} + \frac{\square}{\square} = \frac{\square}{\square}$

39. 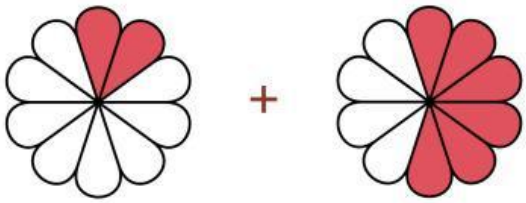 $+ \quad = \frac{\square}{\square} + \frac{\square}{\square} = \frac{\square}{\square}$

40. 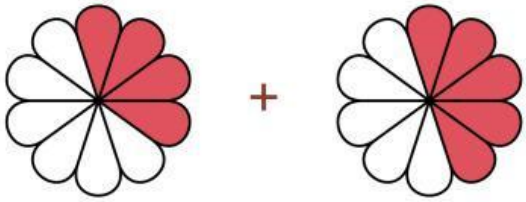 $+ \quad = \frac{\square}{\square} + \frac{\square}{\square} = \frac{\square}{\square}$

LIVEWORKSHEETS