LKPD
Matematika

Bab 3 : Bentuk Di Sekitar Kita

Kelompok : _____

1.
2.
3.
4.

Di Susun Oleh:
WINDA DYAN LISTIANI, S.Pd.

2

LIVEWORKSHEETS

BANGUN DATAR

Isi nama bangun datar di bawah ini!





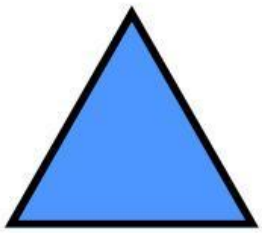

Lingkaran

Segitiga

Persegi Panjang

Persegi

LIVEWORKSHEETS

Mencocokkan Bentuk

Tariklah garis gambar bangun datar yang memilik bentuk sama

LIVEWORKSHEETS

Memasangkan Bangun Datar

Hubungkan tumpukan bangun datar dengan komposisi yang tepat!

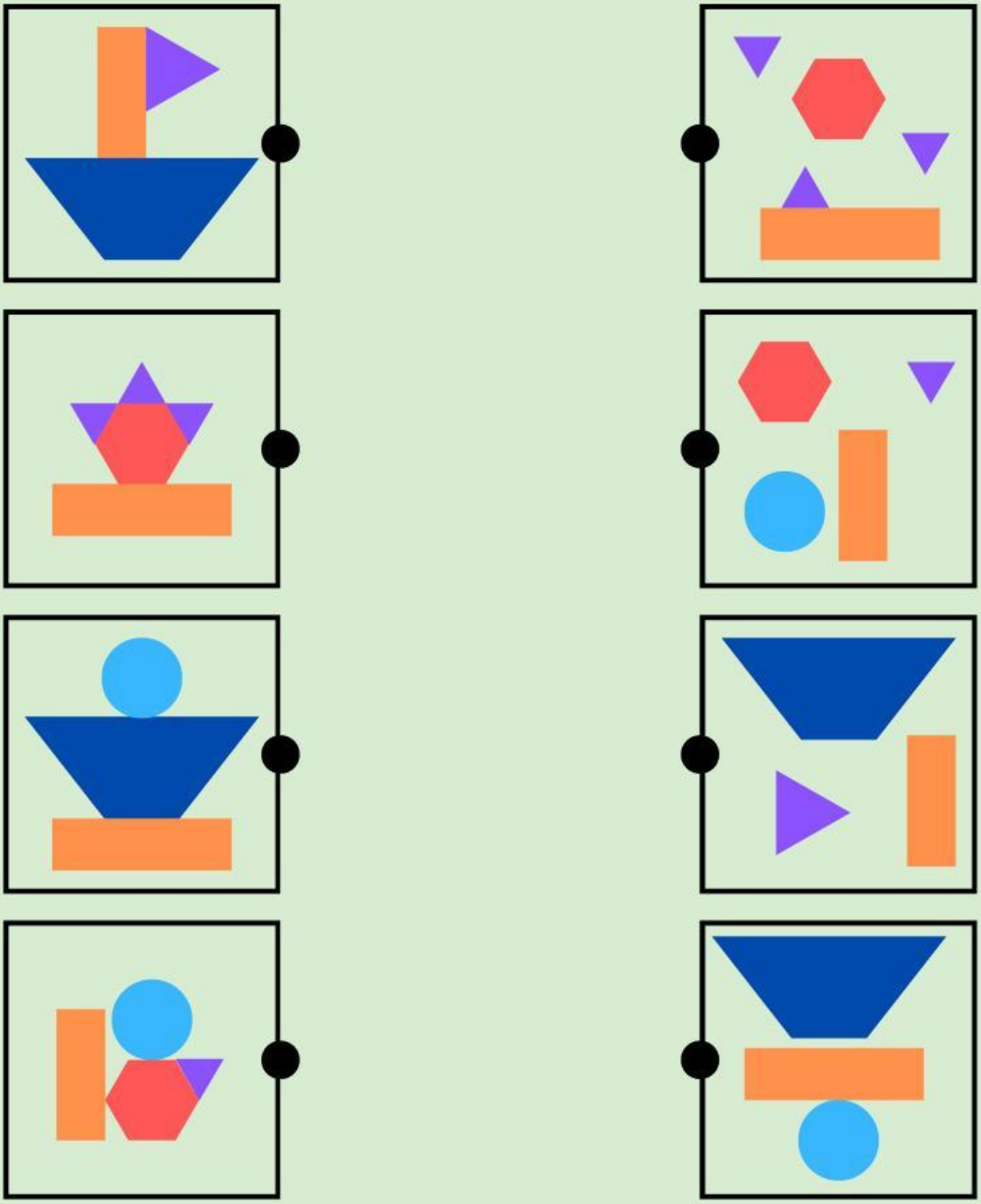

LIVEWORKSHEETS