Cognome Nome Classe Data

INSERISCI LE PAROLE GIUSTE :

PUNTO RETTA PIANO SPAZIO SEGMENTO

SEMIRETTA ANGOLO

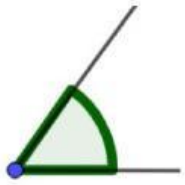	
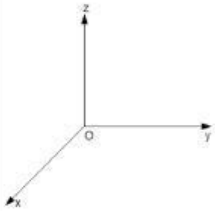	

LIVEWORKSHEETS

Cognome Nome Classe Data

INSERISCI LE PAROLE GIUSTE :

ANGOLO RETTO ANGOLO PIATTO ANGOLI OPPOSTI AL VERTICE

DUE ANGOLI COMPLEMENTARI DUE ANGOLI SUPPLEMENTARI

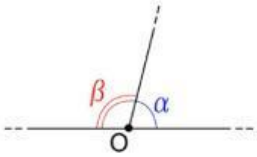	
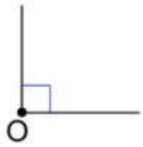	
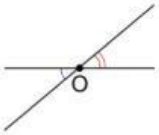	
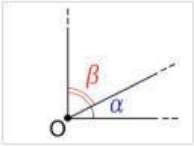	
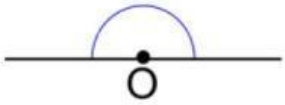	

AB + CD = 99 cm
CD = AB + 23 cm

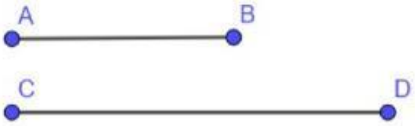

AB = …….
CD = ……..

α


β

α + β = 240°
α - β = 66°
α = …… β = ……..

LIVEWORKSHEETS