Find Missing Numbers

1) Use the bar models to help complete the calculations.

a) 96 + 53 = 100 + ☐

b) 48 + 122 = 50 + ☐

c) 995 + 243 = ☐ + 1000

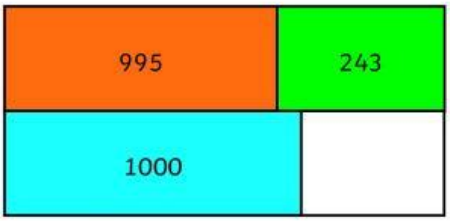

2) Use the number lines to help complete the calculations.

a) 476 − 93 = ☐ − 100

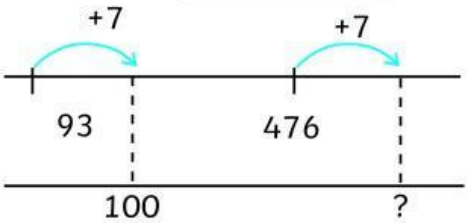

b) ☐ − 1000 = 7652 − 1005

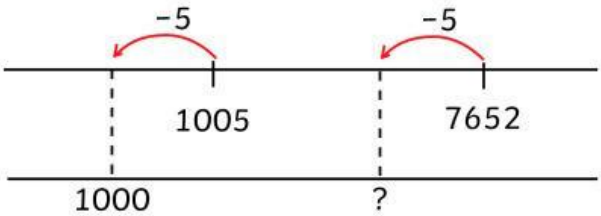

3) Work out the missing numbers.

a) 1790 + 4302 = 1800 + ☐

b) 8625 − 790 = ☐ − 800

c) 362 + ☐ = 370 + 1000

d) ☐ − 1000 = 5678 − 1004

Scan here for help!

twinkl
visit twinkl.com
LIVEWORKSHEETS