Key Signatures, Scales & Chords I

What is the name of each of these scales?

1. This is the scale of _____



2. This is the scale of _____



3. This is the scale of _____



4. This is the scale of _____



LIVEWORKSHEETS