HỌ VÀ TÊN:

1 Tính nhẩm.

a) 8 + 6 = 9 + 4 = 7 + 8 =

5 + 7 = 4 + 8 = 8 + 7 =

b) 11 – 8 = 13 – 7 = 17 – 9 =

14 – 6 = 12 – 5 = 16 – 8 =

2 Tìm chuồng cho mỗi con chim.



4 Số ?

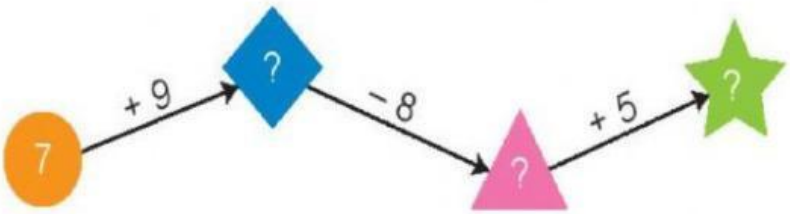

LIVEWORKSHEETS

LIVEWORKSHEETS

5 Tìm hình tiếp theo:

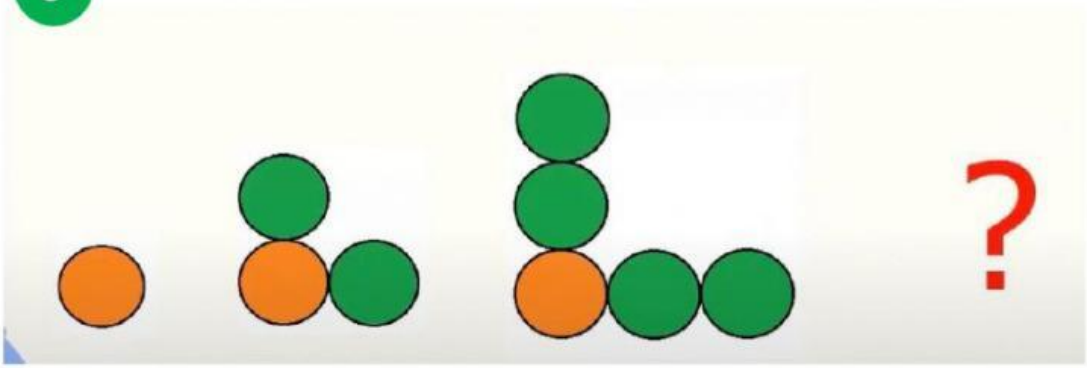

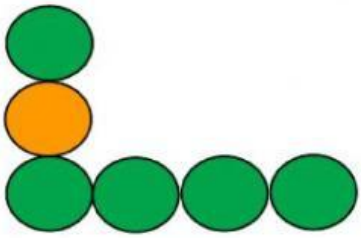

A

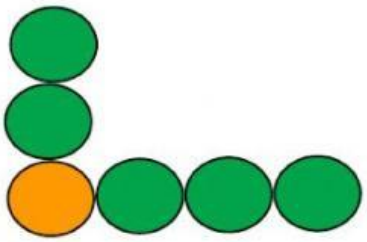

B

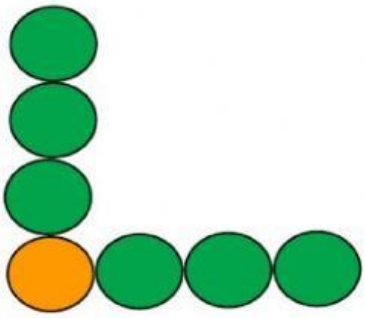

C

LIVEWORKSHEETS

LIVEWORKSHEETS