Nama:

BELAJAR BERHITUNG

Lingkarilah angka yang sesuai dengan gambar berikut ini! Selamat mengerjakan!

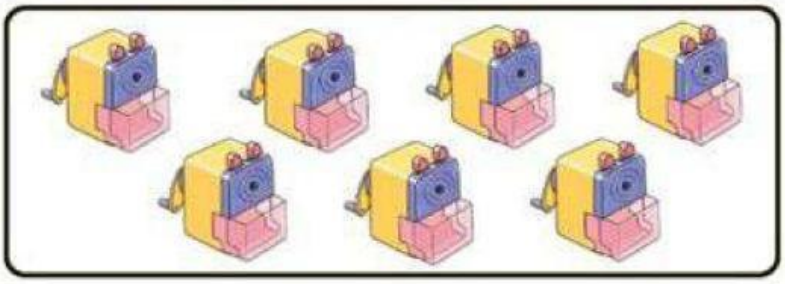

6 7
8 9 10



6 7
8 9 10

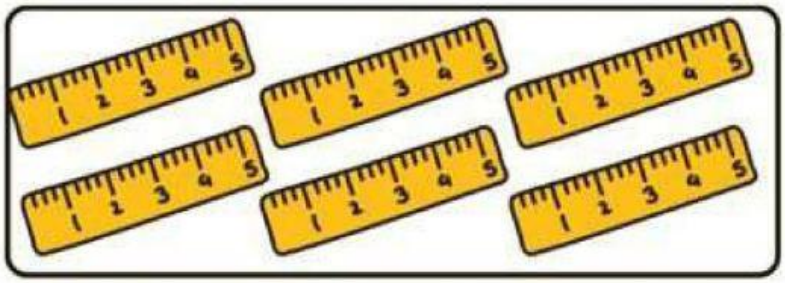

6 7
8 9 10

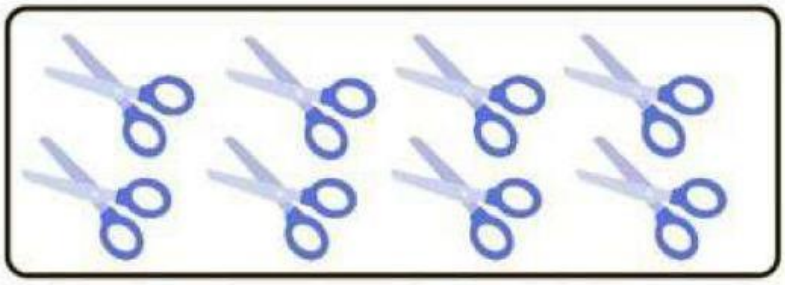

6 7
8 9 10



6 7
8 9 10

@yenisarodja

LIVEWORKSHEETS

CARI DAN HITUNG

Nama : _____

Tanggal : _____

Nilai :

Ayo bantu Diyah untuk mencari dan menghitunglah gambar makanan pada kotak yang telah disediakan !



@cahya507

LIVEWORKSHEETS

speechandsmiile.com

COUNT AND COLOR

Count the objects and color the correct number.

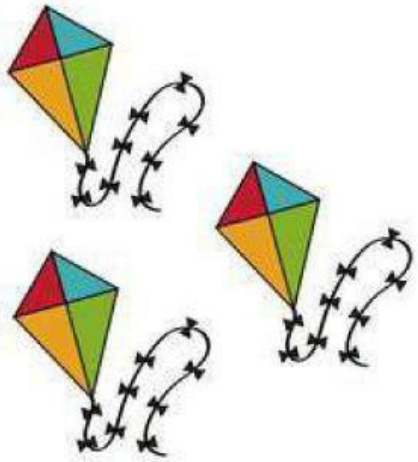	3 4 5		6 7 8
	4 5 6	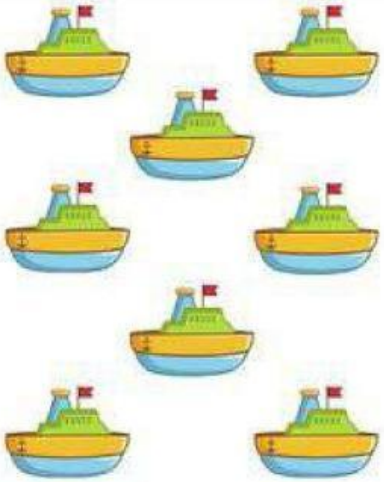	7 8 9
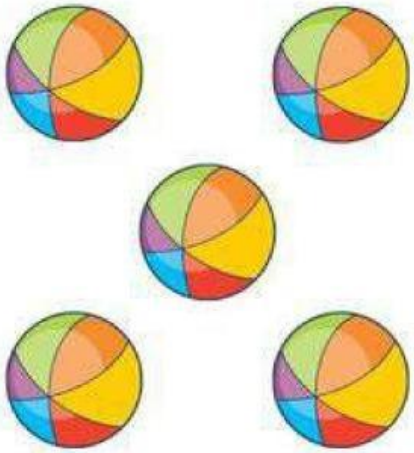	5 6 7		8 9 10

LIVEWORKSHEETS

PENJUMLAHAN DAN PENGURANGAN

3 + 5	10
3 + 5 +2	18
10 + 4	8
10 + 4 +4	27
15 + 12	61
23 + 23	46
41 + 20	14

Matematika Seru

8 - 3	5
8 - 3 - 1	30
14 - 4	10
14 - 4 - 2	4
25 - 12	16
38 - 22	8
63 - 30	13

Worksheet Inka Ngilmi
LIVEWORKSHEETS

Nama : Kelas :

PERKALIAN

@yenisarodja

X	1	2	3	4	5	6	7	8	9	10
4										

Isi bilangan yang tepat pada kotak yang kosong dan gunakan tabel perkalian yang telah tersedia.

- 5 x ___ = 20
- 4 x ___ = 32
- ___ x 4 = 28
- ___ x 4 = 16
- ___ x 4 = 24
- 10 x ___ = 40

Bandingkan dan beri tanda < , = , atau >

- 7 x 4 ☐ 26
- 2 x 4 ☐ 6 x 3
- 5 x 4 ☐ 22
- 4 x 9 ☐ 36

LIVEWORKSHEETS

Nama :

Kelas :

Latihan Soal Pecahan

Kerjakan soal pecahan berikut ini!

1.

$\frac{1}{4}$

2. 

$\frac{...}{...}$

3.

$\frac{...}{...}$

4.

$\frac{...}{...}$

5.

$\frac{...}{...}$

6.

$\frac{...}{...}$

7. 

$\frac{...}{...}$

8. 

$\frac{...}{...}$

9.

$\frac{...}{...}$

10. 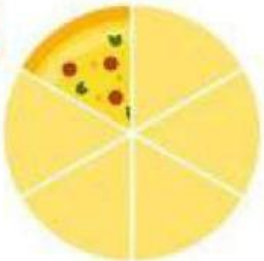

$\frac{...}{...}$

LIVEWORKSHEETS