SEP
SECRETARÍA DE EDUCACIÓN PÚBLICA

CENTRO DE BACHILLERATO TECNOLOGICO
Industrial y de servicios N°
Marzo 2021

ÁNGULOS FORMADOS POR RECTAS PARALELAS Y SECANTE

1. En la figura m // n. Hallar el valor de "x".

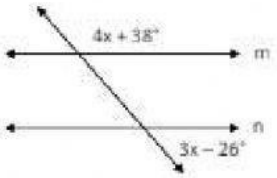

X =

2. Hallar el valor de "x", $\ell_1 // \ell_2$

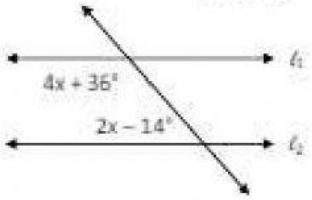

X =

3. Hallar el valor de "x", m // n.

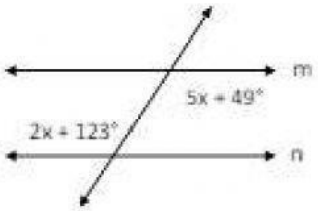

X =

6. Hallar el valor de "x", r // n.

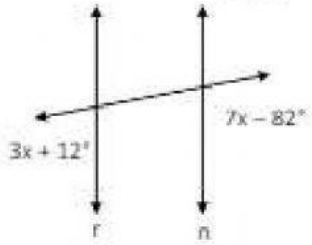

X =

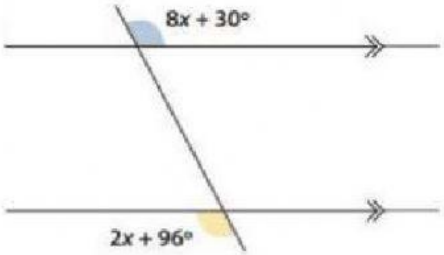

X =

Si $L_1//L_2$, calcule el valor de "x"

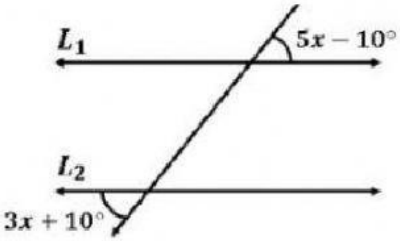

X =

LIVEWORKSHEETS