# DIFERENCIA Y DIFERENCIA SIMÉTRICA DE CONJUNTOS

Sean los conjuntos:

A={1; 2; 3; 6}  B={2; 4; 6; 7; 8}

Entonces: A – B={1 ; 3}  B – A={4 ; 7 ; 8}

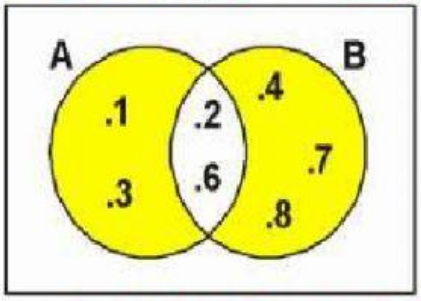


Luego: A∆B = { 1; 3; 4; 7; 8 }

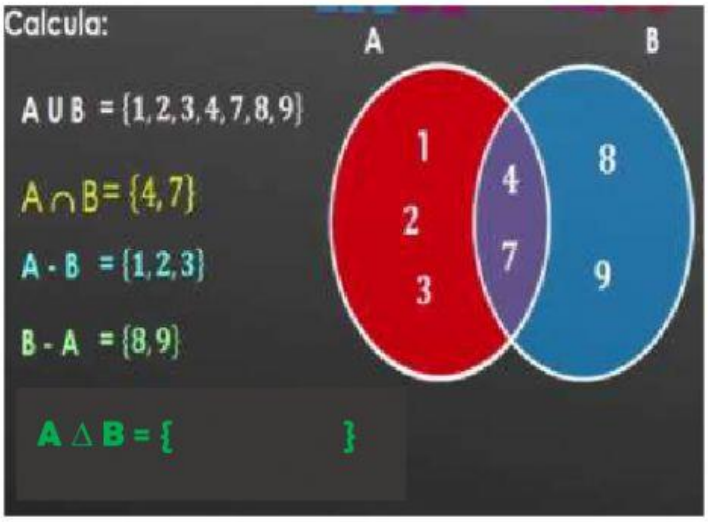


## 1.-Halla lo que se indique:

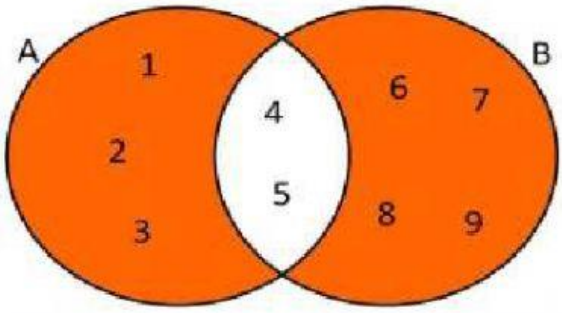


A – B = { }

B – A = { }

A △ B = { }

## 2.-Halla lo que se indique:

A U B = { }

A ∩ B= { }

A - B = { }

B - A = { }

A △ B = { }

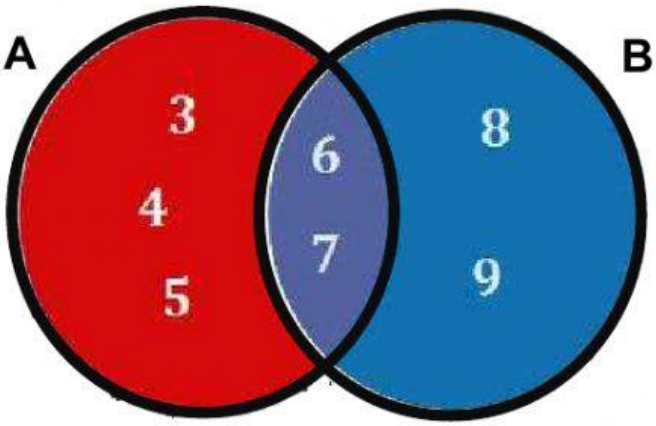


LIVEWORKSHEETS
LIVEWORKSHEETS