المدرسة العصرية العالمية
MODERN INTERNATIONAL SCHOOL
تحت إشراف وزارة التربية والتعليم
(Under the supervision of Ministry of Education, Oman)

## Worksheet – Mass and Capacity

**Name: _____ Grade: 6 ___ Date: _____**

Convert kilograms to grams

1. 16 kg = _____ g
2. 6 kg = _____ g
3. 8 kg = _____ g
4. 2 kg = _____ g
5. 4 kg = _____ g
6. 50 kg = _____ g
7. 83 kg = _____ g
8. 99 kg = _____ g
9. 69 kg = _____ g
10. 7 kg = _____ g

Convert grams to kilograms

11. 200,000 g = _____ kg
12. 300,000 g = _____ kg
13. 80,000 g = _____ kg
14. 100,000 g = _____ kg
15. 400,000 g = _____ kg
16. 10,000 g = _____ kg
17. 40,000 g = _____ kg
18. 70,000 g = _____ kg
19. 60,000 g = _____ kg
20. 50,000 g = _____ kg

LIVEWORKSHEETS

Find the volume of the juice in milliliters (mL) in the following measuring cups.

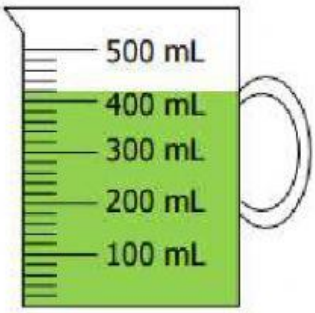


1) _____ mL

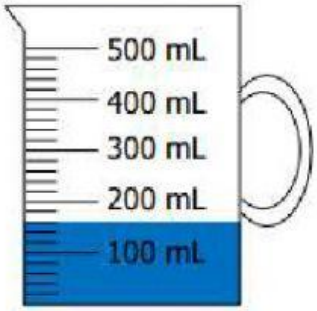


2) _____ mL

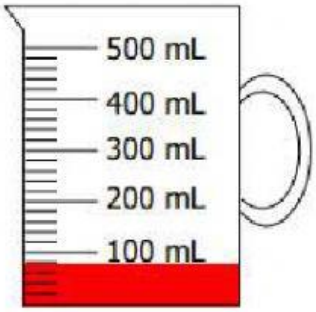


3) _____ mL

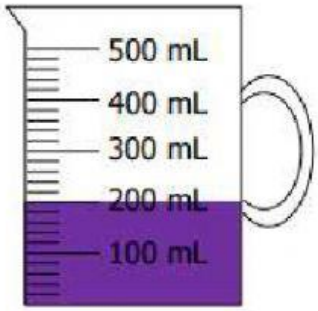


4) _____ mL

Convert litres to milliliters

1. 5 L = _____ mL
2. 22 L = _____ mL
3. 28 L = _____ mL
4. 27 L = _____ mL
5. 9 L = _____ mL
6. 78 L = _____ mL
7. 34 L = _____ mL
8. 42 L = _____ mL
9. 87 L = _____ mL
10. 84 L = _____ mL

Convert milliliters to liters

11. 30,000 mL = _____ L
12. 7,000 mL = _____ L
13. 10,000 mL = _____ L
14. 6,000 mL = _____ L
15. 1,000 mL = _____ L
16. 5,000 mL = _____ L
17. 2,000 mL = _____ L
18. 4,000 mL = _____ L
19. 8,000 mL = _____ L
20. 40,000 mL = _____ L

LIVEWORKSHEETS