Identifikasi Jenis-Jenis Bangun Ruang

Pasangkanlah bangun yang sesuai dengan memberikan garis penghubung pada titik yang ada

- Tabung
- Kerucut
- Kubus
- Prisma
- Balok
- Bola
- Limas

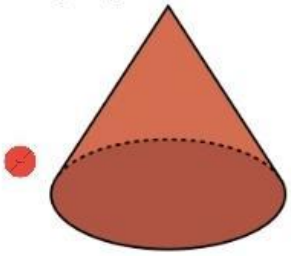

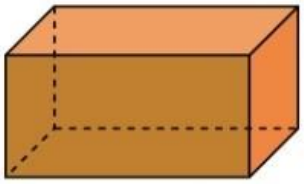



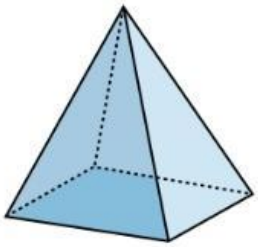

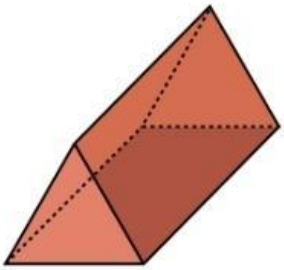

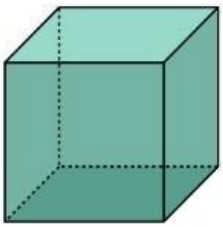

LIVEWORKSHEETS

Identifikasi Jaring-Jaring Bangun Ruang

Pasangkanlah bangun yang sesuai dengan memberikan garis penghubung pada titik yang ada

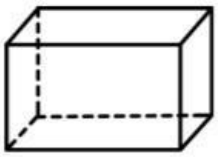

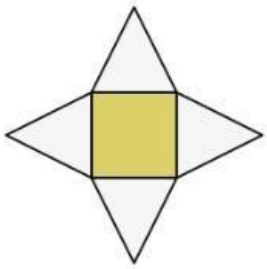

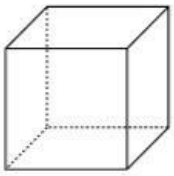

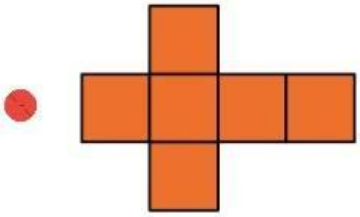

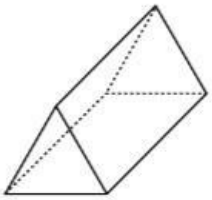

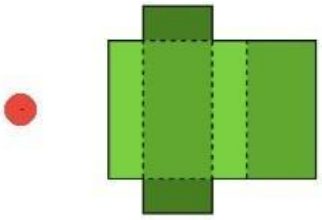

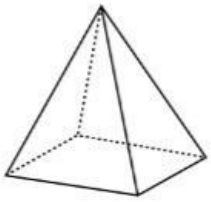

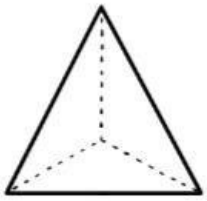

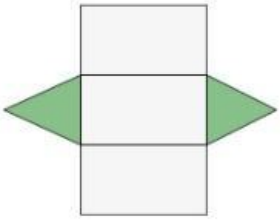

LIVEWORKSHEETS

Identifikasi Jaring-Jaring Bangun Ruang

Pasangkanlah bangun yang sesuai dengan memberikan garis penghubung pada titik yang ada

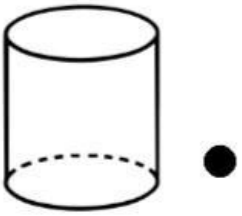

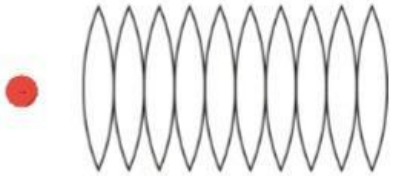

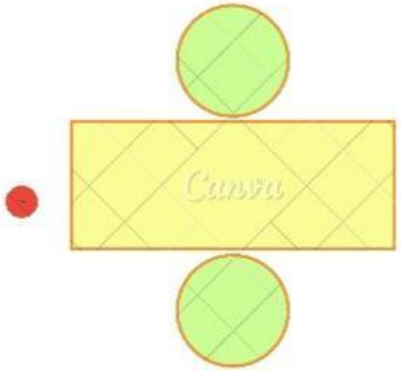

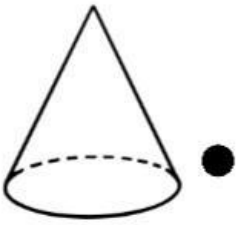

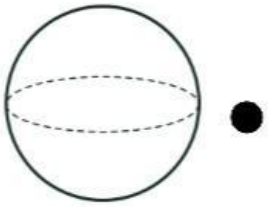

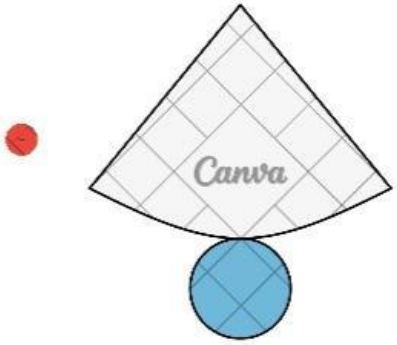

LIVEWORKSHEETS

Identifikasi Sisi, Rusuk, dan Titik Sudut

Isilah data berikut dengan benar

	Nama Bangun	Jumlah		
		Sisi	Rusuk	Titik Sudut
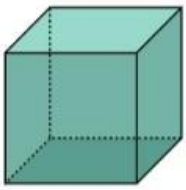	.....	....	....	....
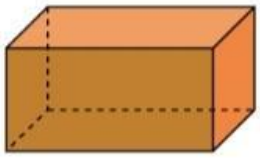	.....	....	....	....
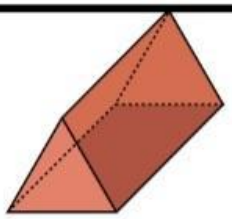	.....	....	....	....
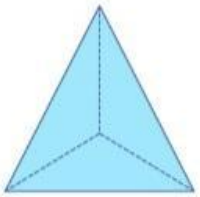	.....	....	....	....
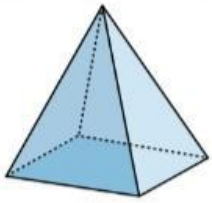	.....	....	....	....
	.....	....	....	....
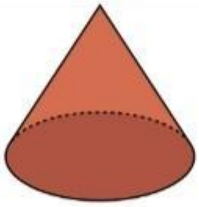	.....	....	....	....
	.....	....	....	....

LIVEWORKSHEETS