LKPD

Bilangan 1-10

Perhatikan video berikut ini!

Tugas

Urutkan bilangan yang hilang dengan bilangan di bawah kotak!

	2			5
	7	8		10

4 9 1 3 6

LIVEWORKSHEETS

Lembar Kerja Peserta Didik (LKPD)

Nama Siswa :

No. Absen :

Tariklah garis pada gambar jari sesuai bilangan!

1.

2.

3. 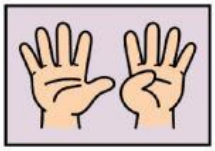

4. 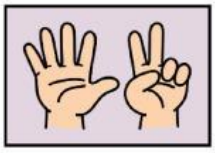

5.

6.

7. 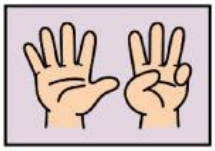

8.

9. 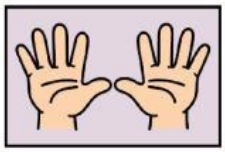

10. 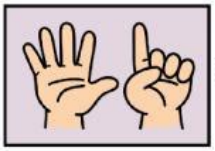

- 9
- 3
- 1
- 2
- 7
- 5
- 4
- 8
- 6
- 10

LIVEWORKSHEETS