LEMBAR KERJA PESERTA DIDIK

LKPD

Pecahan Senilai

MATEMATIKA V

Nama Kelompok :

Kelas :

LIVEWORKSHEETS

LKPD

Pecahan Senilai

Pasangkan gambar berikut dengan bilangan pecahan senilai sesuai dengan yang di arsir.

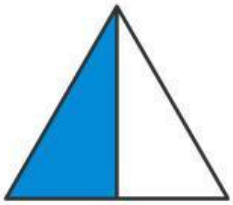

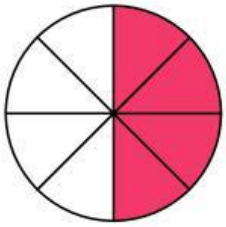



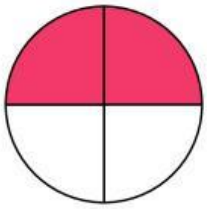

$\frac{1}{4}$

LIVEWORKSHEETS

Pecahan Senilai

Isilah titik-titik di bawah ini dengan bilangan pecahan sesuai dengan yang di arsir.

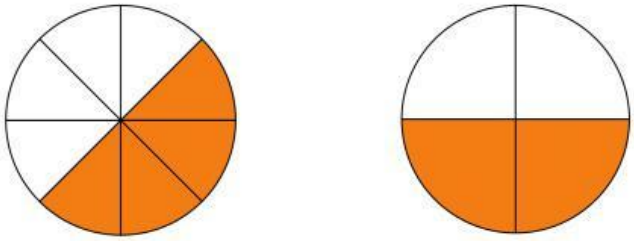

$\frac{\quad}{\quad} = \frac{\quad}{\quad}$

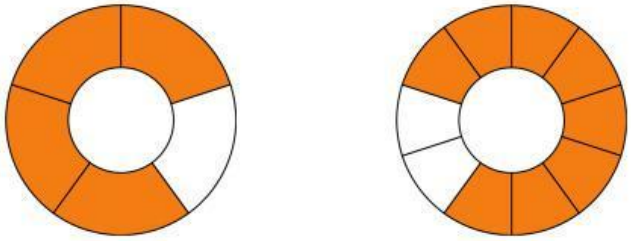

$\frac{\quad}{\quad} = \frac{\quad}{\quad}$

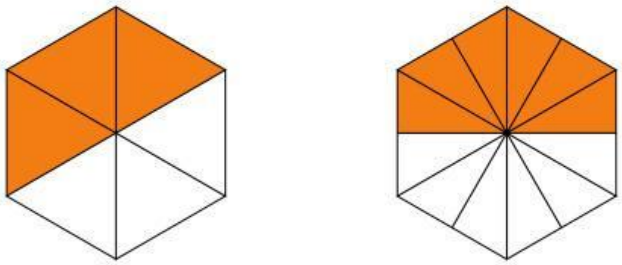

$\frac{\quad}{\quad} = \frac{\quad}{\quad}$

$\frac{\quad}{\quad} = \frac{\quad}{\quad}$

LIVEWORKSHEETS

GUNAKAN GAMBAR DIBAWAH INI UNTUK MENYELESAIKAN SOAL

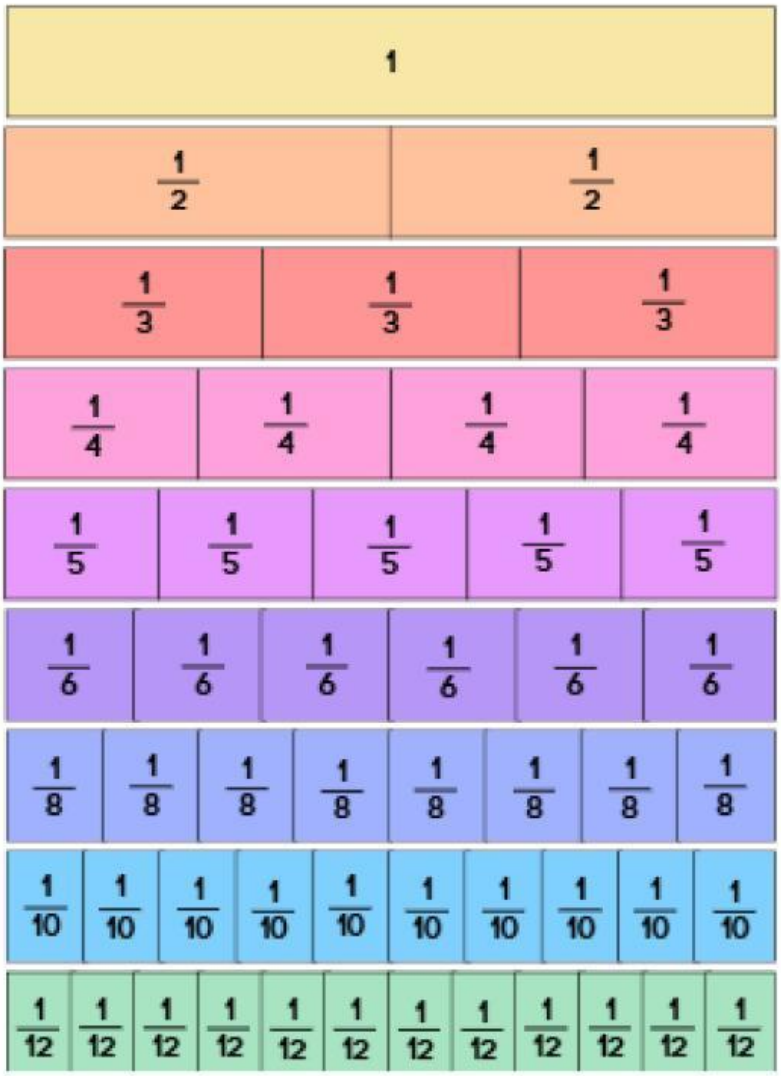

Bacalah pertanyaan dibawah ini!

Berilah tanda centang (✓) jika benar dan jika salah (X) jika salah

Pecahan $\frac{1}{4} = \frac{5}{10}$ ☐

Pecahan $\frac{2}{3} = \frac{3}{6}$ ☐

Pecahan $\frac{1}{2} = \frac{2}{4}$ ☐

Pecahan $\frac{3}{6} = \frac{6}{12}$ ☐

Pecahan $\frac{1}{3} = \frac{3}{6}$ ☐

Pecahan $\frac{2}{8} = \frac{1}{4}$ ☐

LIVEWORKSHEETS