# ¿Con qué lo medirías?

cm = centímetro

m = metro

| m | cm |
|---|---|

| m | cm |
|---|---|

| m | cm |
|---|---|

| m | cm |
|---|---|

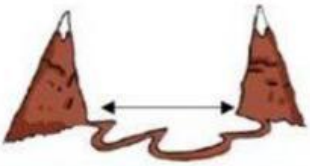

| m | cm |
|---|---|

| m | cm |
|---|---|

| m | cm |
|---|---|

| m | cm |
|---|---|

| m | cm |
|---|---|

| m | cm |
|---|---|

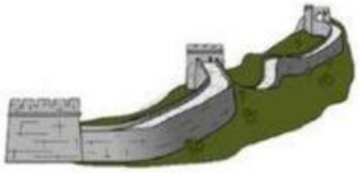

| m | cm |
|---|---|



| m | cm |
|---|---|

LIVEWORKSHEETS