PERÍMETRO Y ÁREA DE FIGURAS

INSTRUCCIONES. ESCRIBE EL PERÍMETRO DE CADA FIGURA.



7.5 m

P = m

9 m

P = m

13 m

P = m

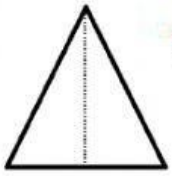

17 m

P = m

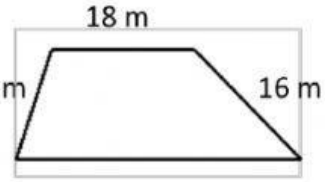

22 m

P = m

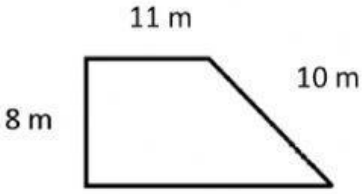

14 m

P = m

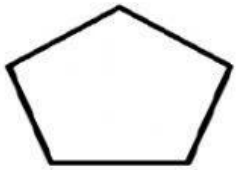

21 m

P = m

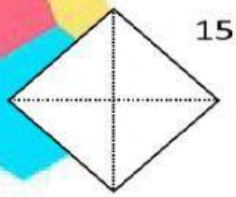

P = m

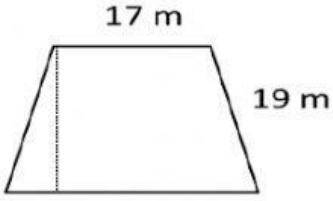

23 m

P = m

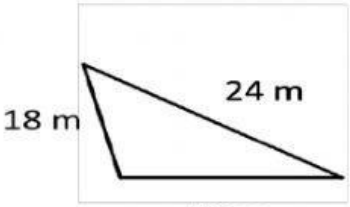

20 m

P = m

LIVEWORKSHEETS

INSTRUCCIONES. ESCRIBE EL ÁREA DE CADA FIGURA.

9.5 m

A = m²

13 m

A = m²

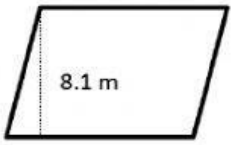

15.2 m

A = m²

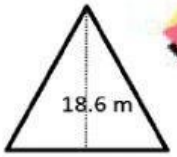

21.5 m

A = m²

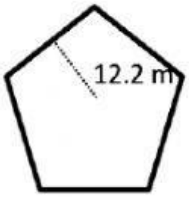

10.5 m

A = m²

14 m

A = m²

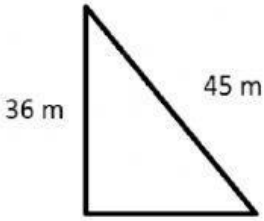

27 m

A = m²

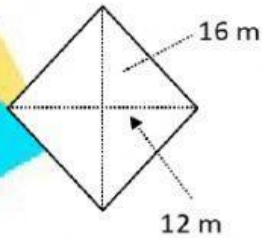

A = m²

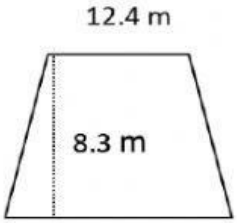

19.6 m

A = m²

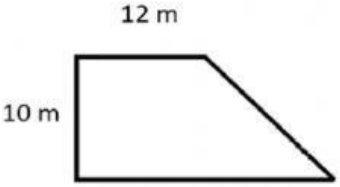

18 m

A = m²

LIVEWORKSHEETS