SOAL MATEMATIKA KELAS 5
JARING-JARING KUBUS DAN BALOK

A. Isilah titik di bawah ini dengan jawaban yang tepat!

1. Jaring-jaring di samping merupakan jaring-jaring ……

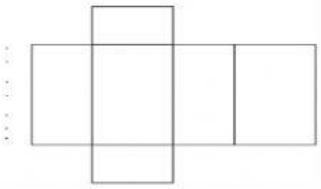

2. Jika nomor 4 alas, maka sisi atas balok adalah nomor …..

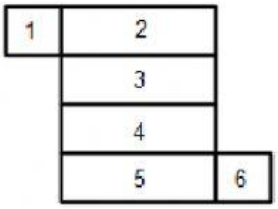

3. Jaring – jaring kubus di samping jika dibuat kubus sehingga sisi "c" sebagai atas, maka yang berada di sisi alas adalah …..

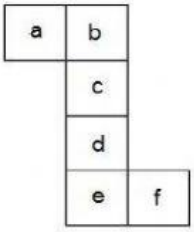

4. Gambar disamping adalah jaring - jaring …..

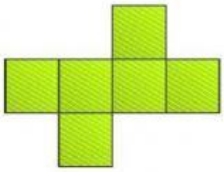

5. Jika **D** adalah alas, maka yang menjadi tutup (atas) kubus adalah . . . .

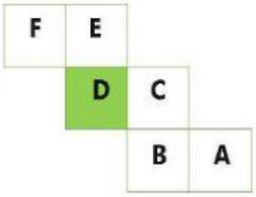

6. Jaring-jaring kubus di samping jika dibuat kubus, maka sisi nomor 2 sejajar dengan sisi ….

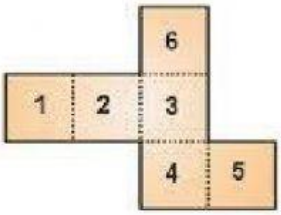

LIVEWORKSHEETS

7. Gambar di samping menunjukkan jaring-jaring balok. Jika persegi nomor 2 merupakan alas kubus, maka penutup atasnya adalah persegi nomor…..

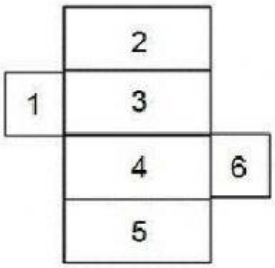

8. Jika nomor 4 alas, maka sisi atas balok adalah nomor …..

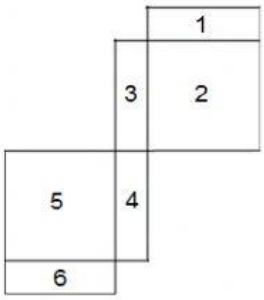

9. Jaring-jaring kubus terdiri dari …… buah persegi.
10. Balok memiliki …… buah rusuk.
11. Yang merupakan jarring-jaring balok adalah ….

(i)

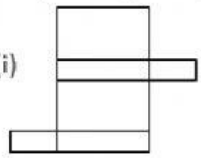

(ii)

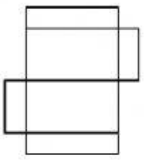

ajarhitung.com

(iii)

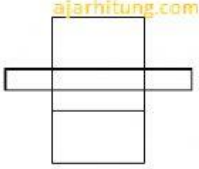

(iv)

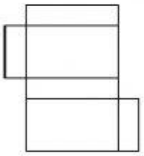

12. Yang bukan merupakan jarring-jaring kubus adalah….

a.

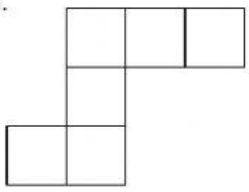

c.



ajarhitung.com

b.



ajarhitung.com

d.



LIVEWORKSHEETS

13.

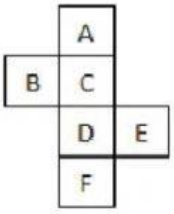

Gambar di samping bila dibuat kubus, maka sisi yang berhadapan adalah ....

a. A dan D
b. B dan F
c. D dan F
d. C dan D

14. Banyaknya sisi pada balok adalah ....

a. 3
b. 5
c. 6
d. 4

15. Gambar di bawah ini yang merupakan jaring – jaring balok adalah ...

a.


c.
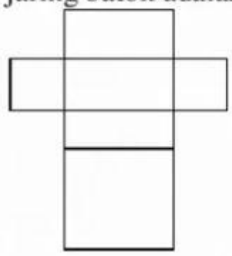

b. .
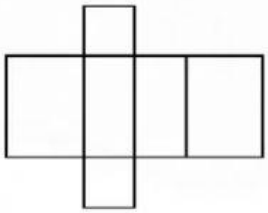

d.
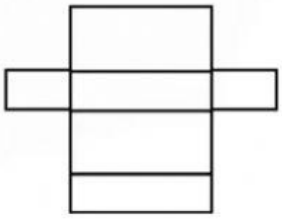

LIVEWORKSHEETS