

LKPD

Matematika

Materi:

Pecahan

Kelas: 4

LIVEWORKSHEETS

Potongan Pizza

Tulislah pecahan yang sesuai dengan sisa potongan pizza. di bawah ini.

$\frac{1}{1}$









LIVEWORKSHEETS

Pecahan Buah Semangka

Perhatikan gambar, kemudian isilah tabel di bawah ini.



Gambar	Pecahan	Cara Membaca

LIVEWORKSHEETS